Moltiplicazioni con la linea numerata

Nome:

Usa la linea numerata per risolvere ogni operazione.

1) 2 × 7 =

7 × 2 =

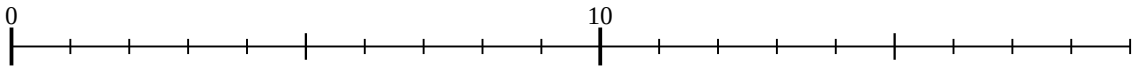

2) 5 × 6 =

6 × 5 =

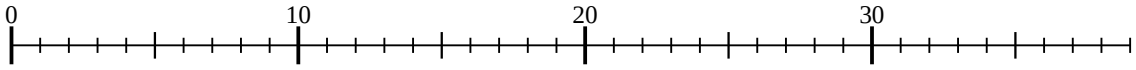

3) 2 × 2 =

2 × 2 =



4) 5 × 3 =

3 × 5 =

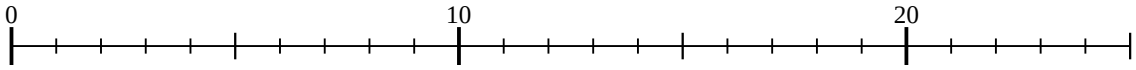

5) 2 × 8 =

8 × 2 =

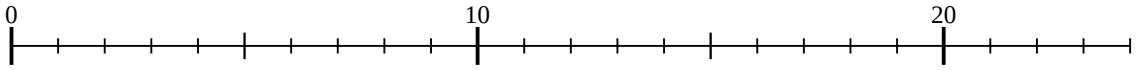

6) 2 × 5 =

5 × 2 =

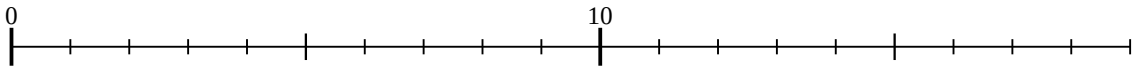

7) 2 × 6 =

6 × 2 =

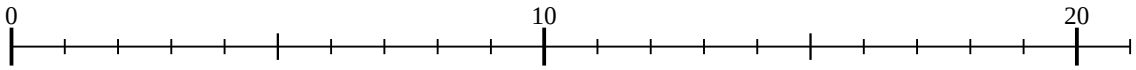

8) 5 × 5 =

5 × 5 =

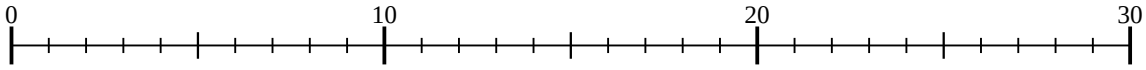

9) 3 × 7 =

7 × 3 =

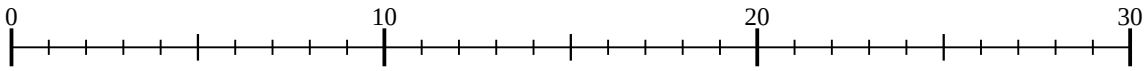

10) 4 × 10 =

10 × 4 =

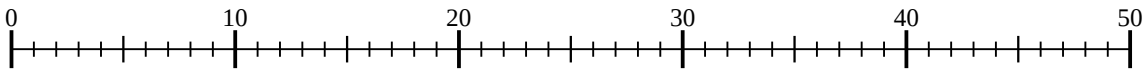

11) 4 × 8 =

8 × 4 =

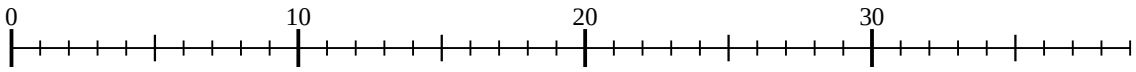

Risposte

1. _____
2. _____
3. _____
4. _____
5. _____
6. _____
7. _____
8. _____
9. _____
10. _____
11. _____

1-10	91	82	73	64	55	45	36	27	18	9
11	0									

Moltiplicazioni con la linea numerata

Nome: **Soluzioni**

Usa la linea numerata per risolvere ogni operazione.

1) 2 × 7 =
7 × 2 =

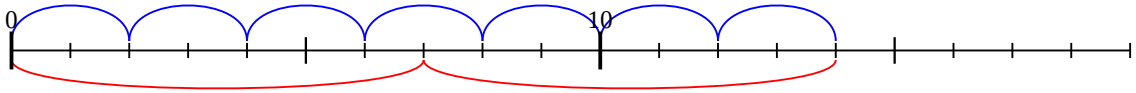

2) 5 × 6 =
6 × 5 =

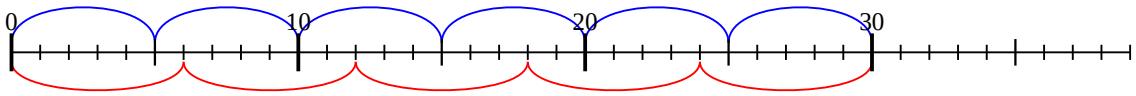

3) 2 × 2 =
2 × 2 =



4) 5 × 3 =
3 × 5 =

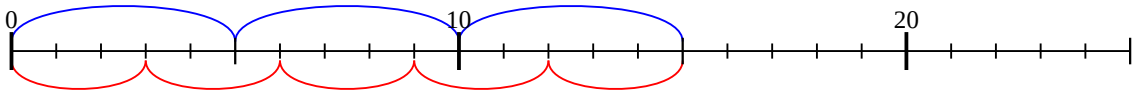

5) 2 × 8 =
8 × 2 =

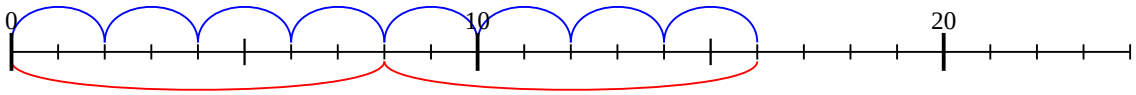

6) 2 × 5 =
5 × 2 =

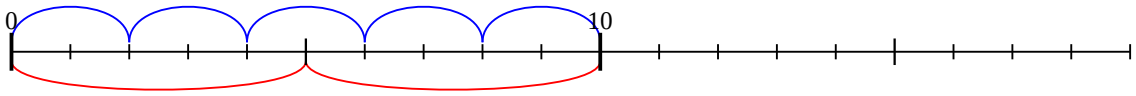

7) 2 × 6 =
6 × 2 =

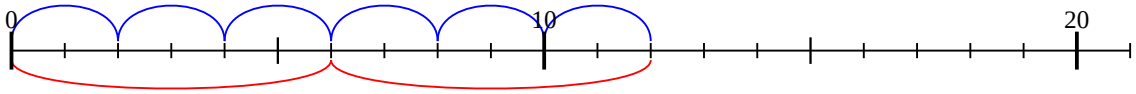

8) 5 × 5 =
5 × 5 =

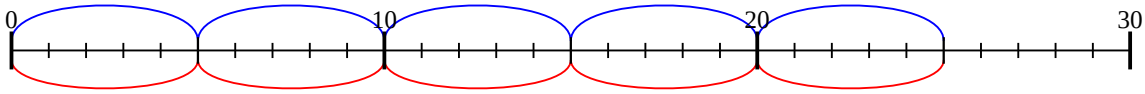

9) 3 × 7 =
7 × 3 =

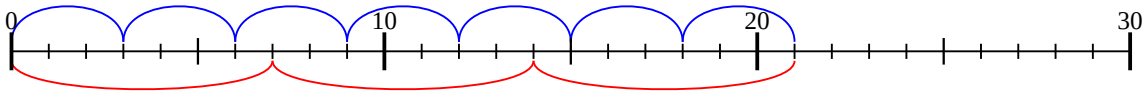

10) 4 × 10 =
10 × 4 =

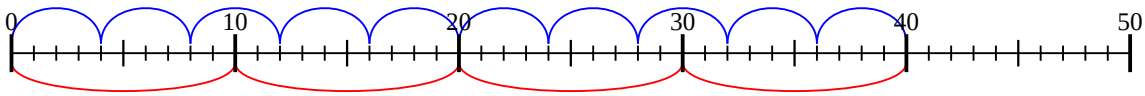

11) 4 × 8 =
8 × 4 =

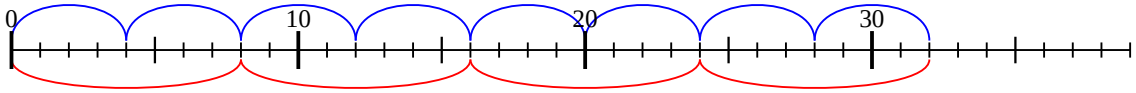

Risposte

1. **14**
2. **30**
3. **4**
4. **15**
5. **16**
6. **10**
7. **12**
8. **25**
9. **21**
10. **40**
11. **32**

1-10	91	82	73	64	55	45	36	27	18	9
11	0									