Moltiplicazioni con la linea numerata

Nome:

Usa la linea numerata per risolvere ogni operazione.

1) 3 × 7 =
7 × 3 =

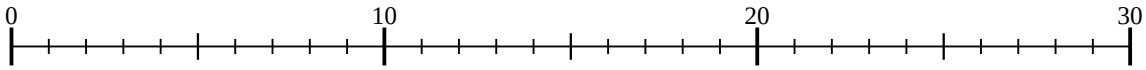

2) 4 × 7 =
7 × 4 =

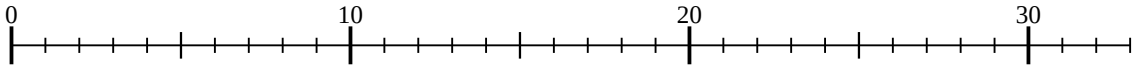

3) 5 × 2 =
2 × 5 =

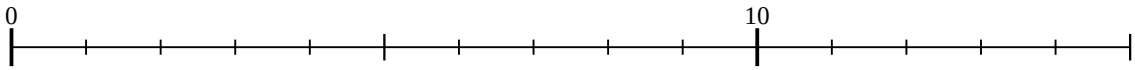

4) 2 × 5 =
5 × 2 =

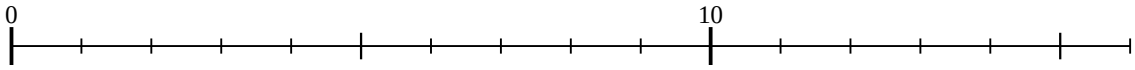

5) 5 × 8 =
8 × 5 =

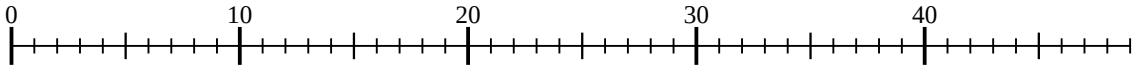

6) 5 × 4 =
4 × 5 =

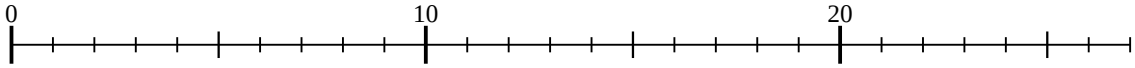

7) 2 × 6 =
6 × 2 =

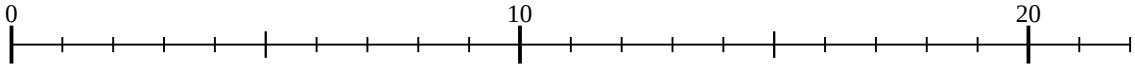

8) 2 × 8 =
8 × 2 =

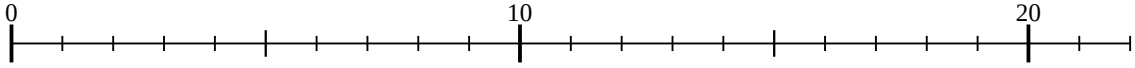

9) 5 × 5 =
5 × 5 =

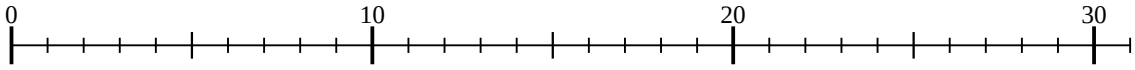

10) 3 × 9 =
9 × 3 =

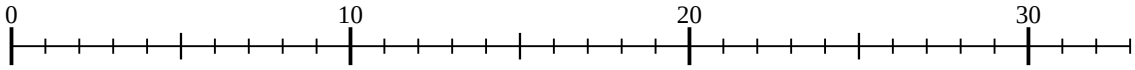

11) 4 × 3 =
3 × 4 =

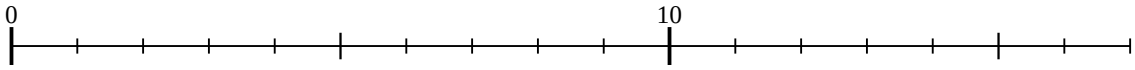

Risposte

1. _____
2. _____
3. _____
4. _____
5. _____
6. _____
7. _____
8. _____
9. _____
10. _____
11. _____

1-10	91	82	73	64	55	45	36	27	18	9
11	0									

Moltiplicazioni con la linea numerata

Nome: **Soluzioni**

Usa la linea numerata per risolvere ogni operazione.

1) 3 × 7 =
7 × 3 =

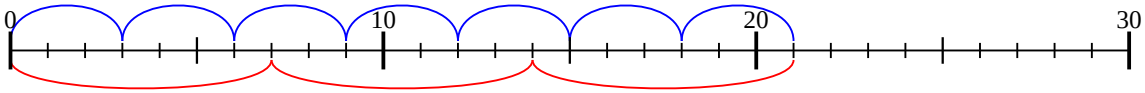

2) 4 × 7 =
7 × 4 =

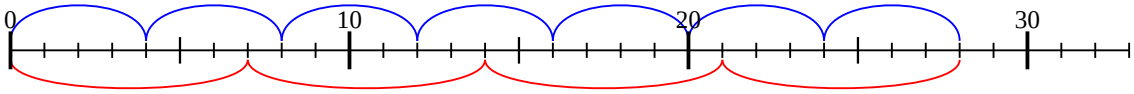

3) 5 × 2 =
2 × 5 =

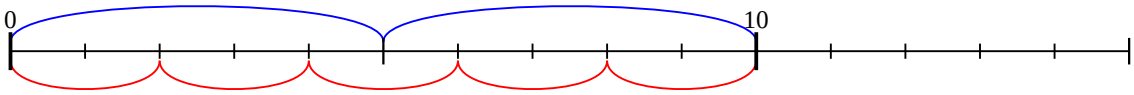

4) 2 × 5 =
5 × 2 =

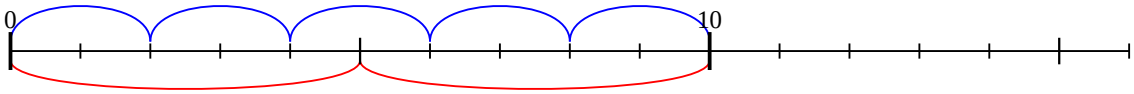

5) 5 × 8 =
8 × 5 =

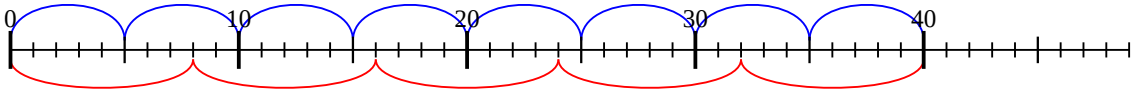

6) 5 × 4 =
4 × 5 =

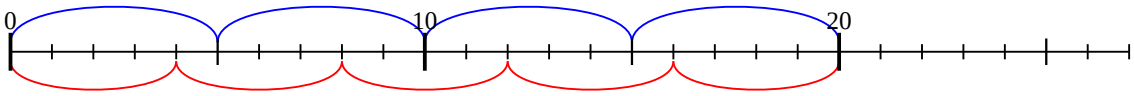

7) 2 × 6 =
6 × 2 =

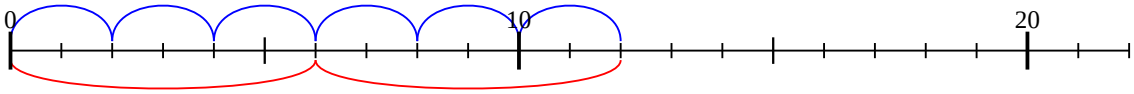

8) 2 × 8 =
8 × 2 =

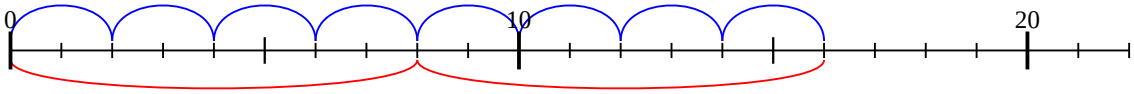

9) 5 × 5 =
5 × 5 =

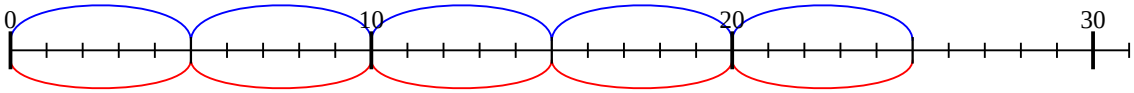

10) 3 × 9 =
9 × 3 =

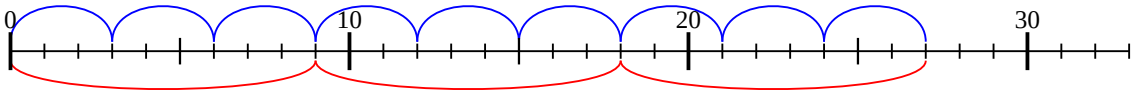

11) 4 × 3 =
3 × 4 =

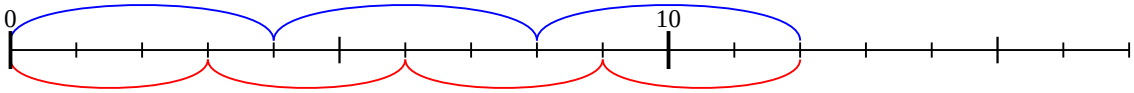

Risposte

1. **21**
2. **28**
3. **10**
4. **10**
5. **40**
6. **20**
7. **12**
8. **16**
9. **25**
10. **27**
11. **12**

1-10	91	82	73	64	55	45	36	27	18	9
11	0									