Moltiplicazioni con la linea numerata

Nome:

Usa la linea numerata per risolvere ogni operazione.

1) 4 × 6 =
6 × 4 =

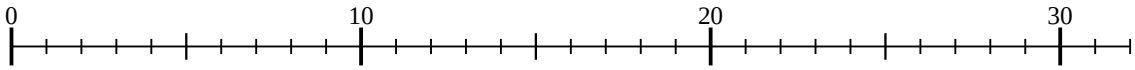

2) 2 × 10 =
10 × 2 =

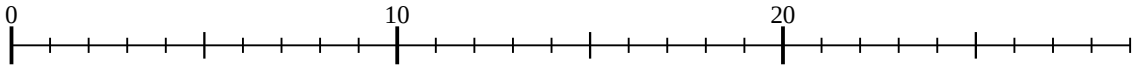

3) 3 × 9 =
9 × 3 =

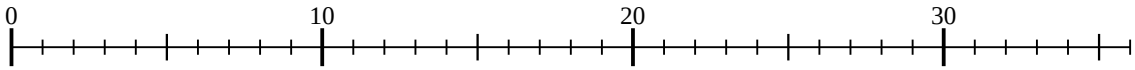

4) 5 × 6 =
6 × 5 =

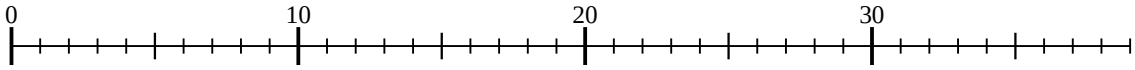

5) 5 × 4 =
4 × 5 =

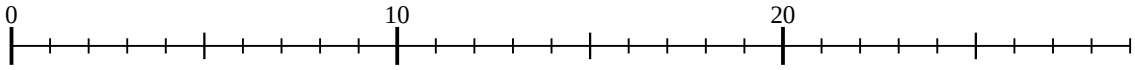

6) 3 × 8 =
8 × 3 =

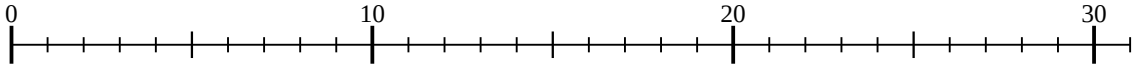

7) 4 × 8 =
8 × 4 =

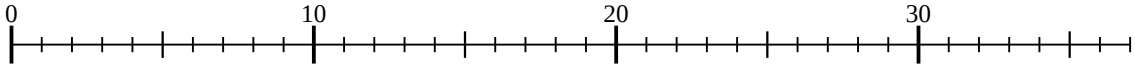

8) 4 × 9 =
9 × 4 =

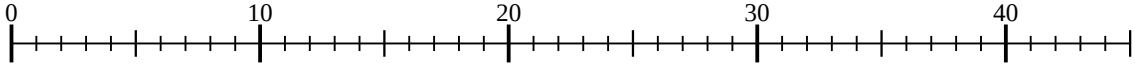

9) 4 × 5 =
5 × 4 =

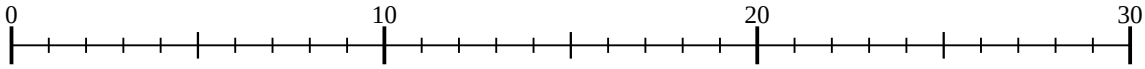

10) 5 × 8 =
8 × 5 =

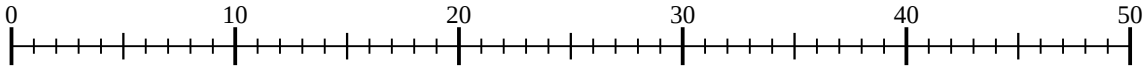

11) 3 × 10 =
10 × 3 =

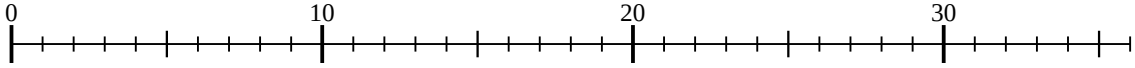

Risposte

1. _____
2. _____
3. _____
4. _____
5. _____
6. _____
7. _____
8. _____
9. _____
10. _____
11. _____

1-10	91	82	73	64	55	45	36	27	18	9
11	0									

Moltiplicazioni con la linea numerata

Nome: **Soluzioni**

Usa la linea numerata per risolvere ogni operazione.

1) 4 × 6 =
6 × 4 =

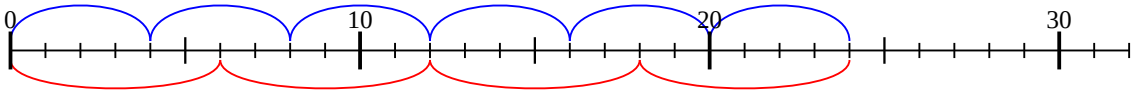

2) 2 × 10 =
10 × 2 =

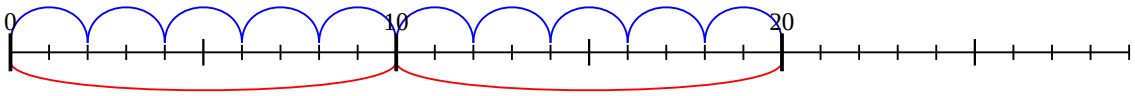

3) 3 × 9 =
9 × 3 =

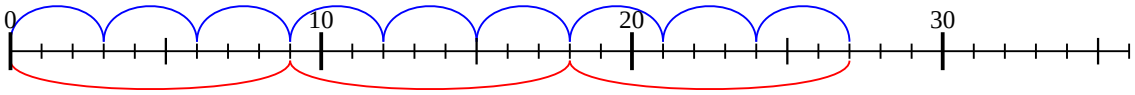

4) 5 × 6 =
6 × 5 =

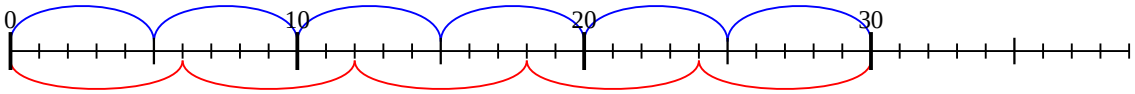

5) 5 × 4 =
4 × 5 =

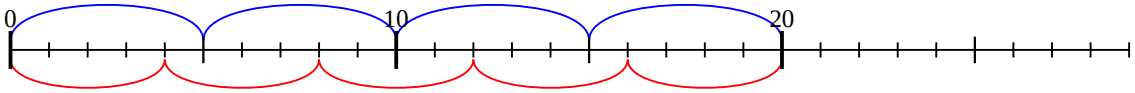

6) 3 × 8 =
8 × 3 =

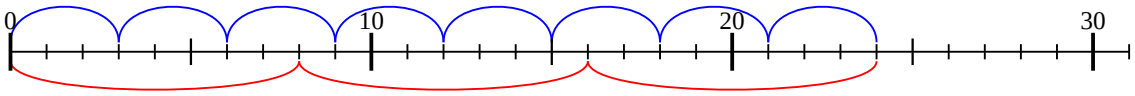

7) 4 × 8 =
8 × 4 =

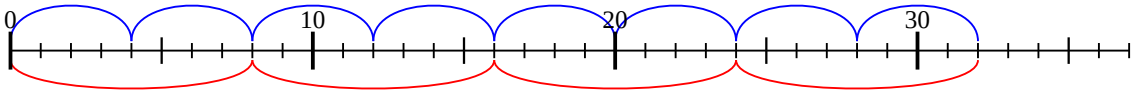

8) 4 × 9 =
9 × 4 =

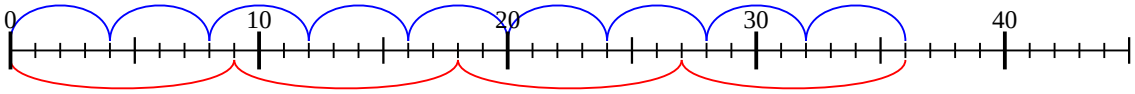

9) 4 × 5 =
5 × 4 =

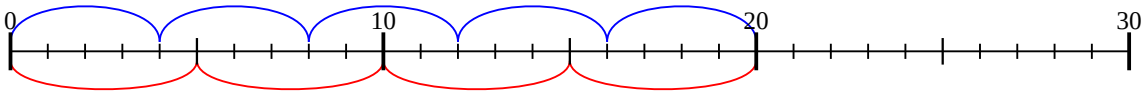

10) 5 × 8 =
8 × 5 =

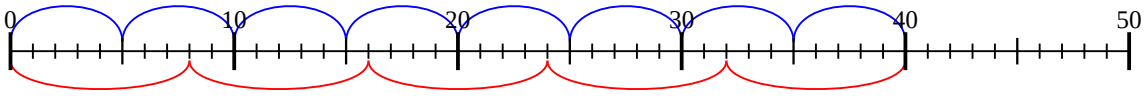

11) 3 × 10 =
10 × 3 =

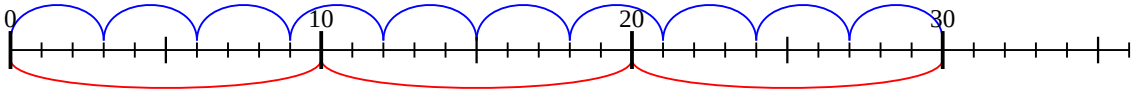

Risposte

1. **24**
2. **20**
3. **27**
4. **30**
5. **20**
6. **24**
7. **32**
8. **36**
9. **20**
10. **40**
11. **30**

1-10	91	82	73	64	55	45	36	27	18	9
11	0									