# Trova la distanza sulla griglia

Nome:

**Trova la distanza tra i due punti.**

**Es)**

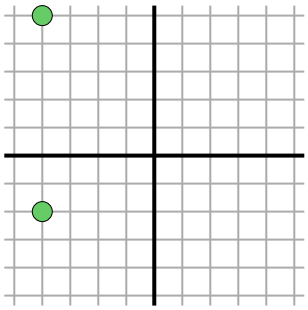

**1)**

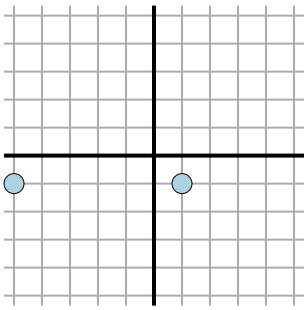

**2)**

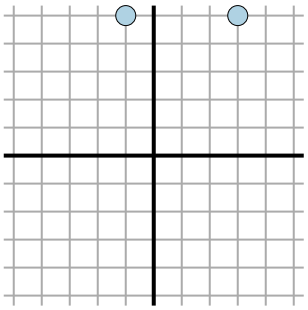

**3)**

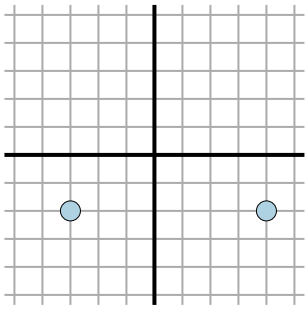

**4)**

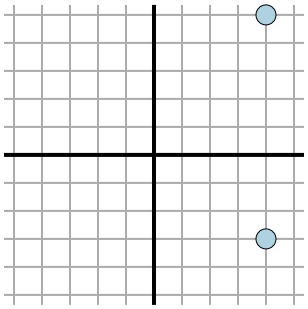

**5)**

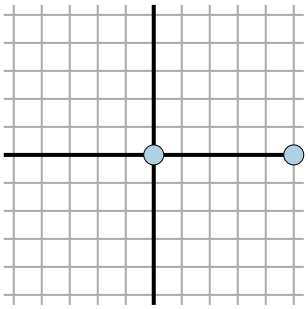

**6)**

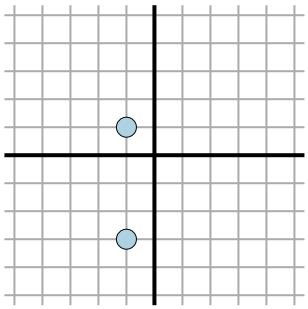

**7)**

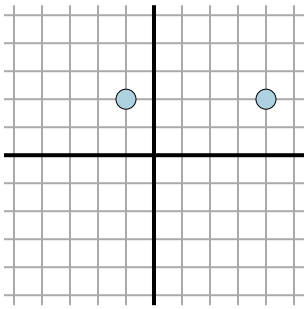

**8)**

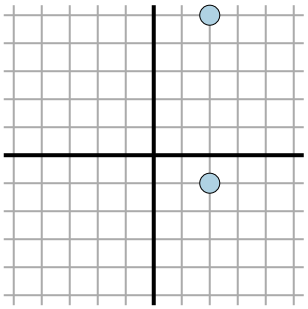

**9)**

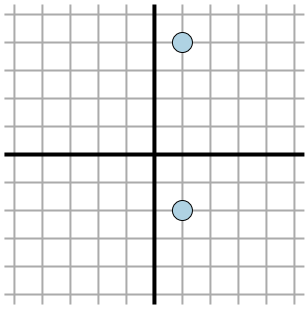

**10)**

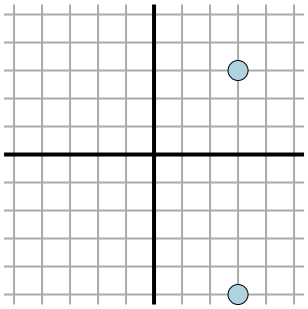

**11)**

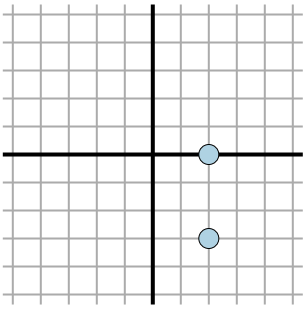

## Risposte

Es. 7

1. _____
2. _____
3. _____
4. _____
5. _____
6. _____
7. _____
8. _____
9. _____
10. _____
11. _____



| | | | | | | | | | | |
|---|---|---|---|---|---|---|---|---|---|---|
| 1-10 | 91 | 82 | 73 | 64 | 55 | 45 | 36 | 27 | 18 | 9 |
| 11 | 0 | | | | | | | | | |

Trova la distanza sulla griglia

Nome: **Soluzioni**

**Trova la distanza tra i due punti.**

**Es)**

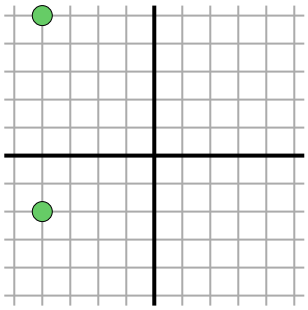

**1)**

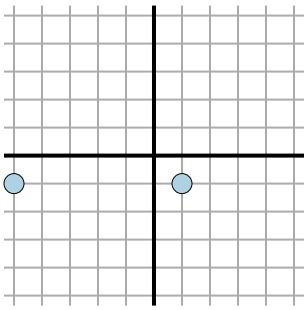

**2)**

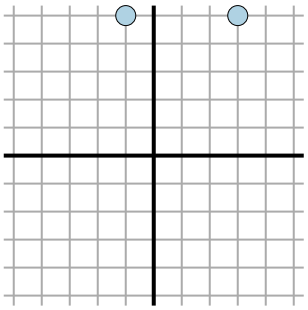

**3)**

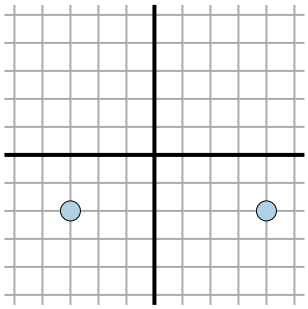

**4)**

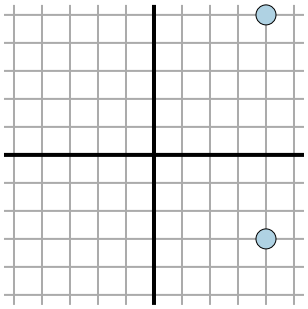

**5)**

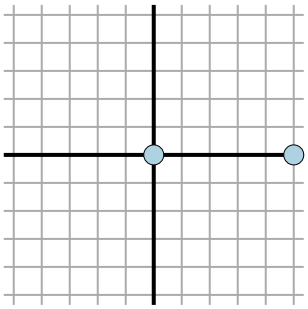

**6)**

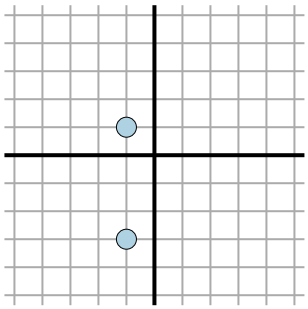

**7)**

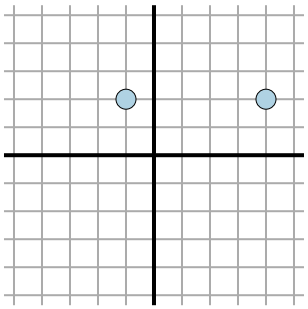

**8)**

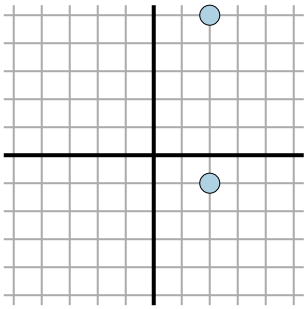

**9)**

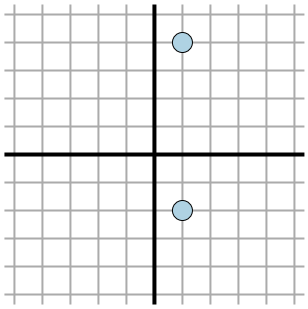

**10)**

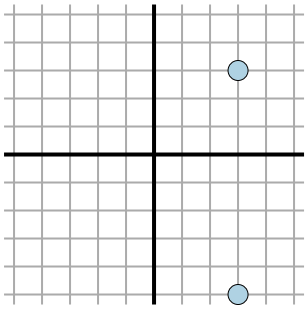

**11)**

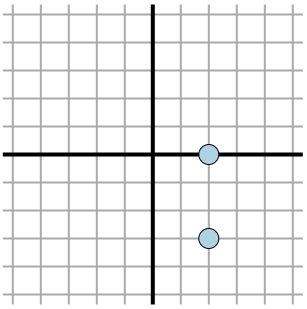

**Risposte**

| | |
|---|---|
| Es. | 7 |
| 1. | 6 |
| 2. | 4 |
| 3. | 7 |
| 4. | 8 |
| 5. | 5 |
| 6. | 4 |
| 7. | 5 |
| 8. | 6 |
| 9. | 6 |
| 10. | 8 |
| 11. | 3 |



| | | | | | | | | | | |
|---|---|---|---|---|---|---|---|---|---|---|
| 1-10 | 91 | 82 | 73 | 64 | 55 | 45 | 36 | 27 | 18 | 9 |
| 11 | 0 | | | | | | | | | |