Trova la distante sulla griglia

Nome:

Trova la distanza tra i punti. Arrotonda il risultato alla decina più vicina.

Es)

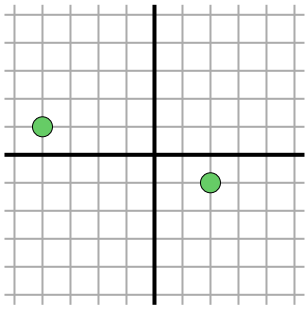

$\sqrt{(-4-2)^2 + (1--1)^2}$

$\sqrt{(36) + (4)}$

1)

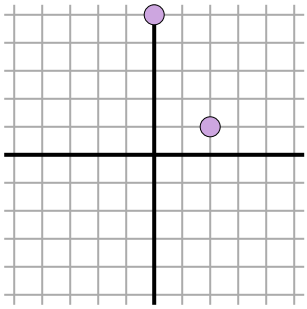

2)

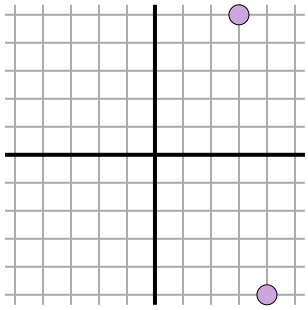

3)

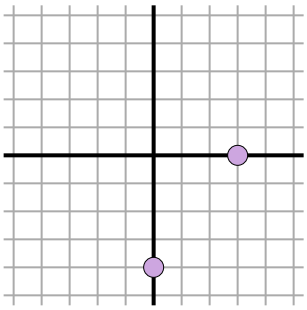

4)

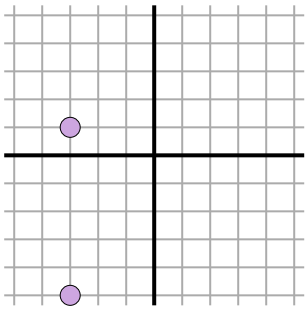

5)

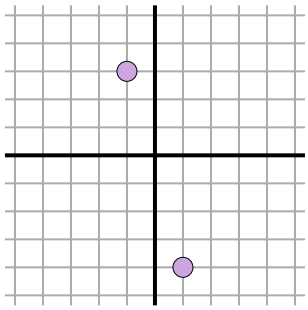

6)

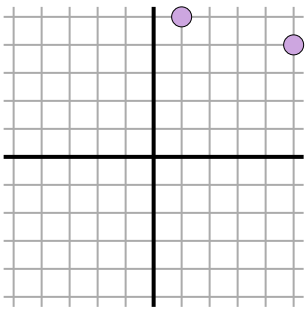

7)

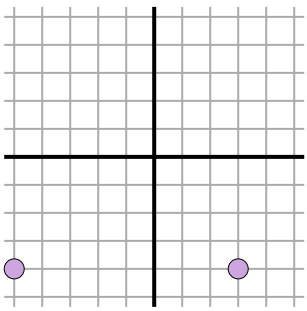

8)

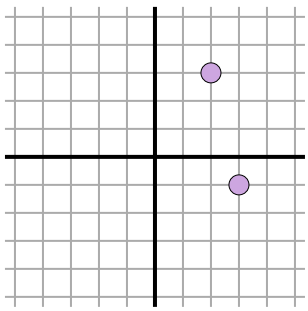

9)

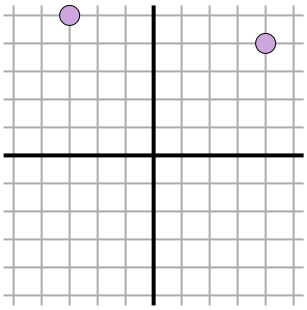

10)

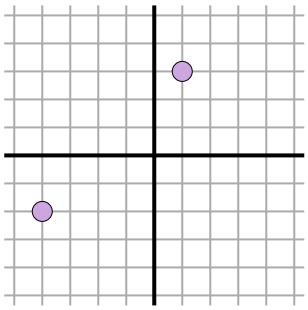

11)

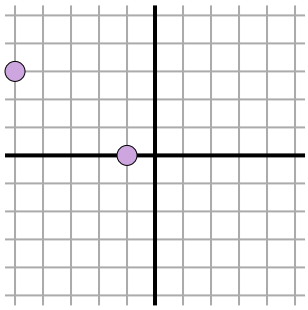

Risposte

Es. 6,3

1. _____
2. _____
3. _____
4. _____
5. _____
6. _____
7. _____
8. _____
9. _____
10. _____
11. _____

Trova la distante sulla griglia

Nome: **Soluzioni**

Trova la distanza tra i punti. Arrotonda il risultato alla decina più vicina.

Es)

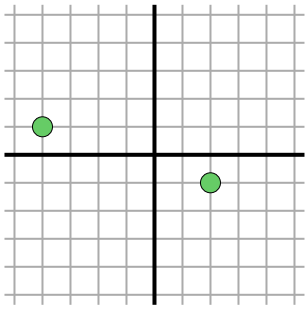

$\sqrt{(-4-2)^2 + (1--1)^2}$

$\sqrt{(36) + (4)}$

1)

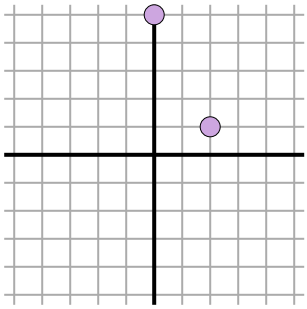

$\sqrt{(2-0)^2 + (1-5)^2}$

$\sqrt{(4) + (16)}$

2)

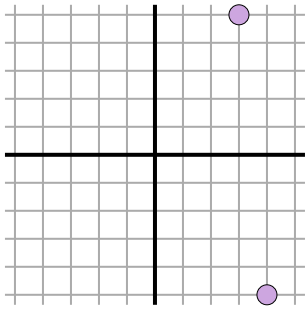

$\sqrt{(4-3)^2 + (-5-5)^2}$

$\sqrt{(1) + (100)}$

3)

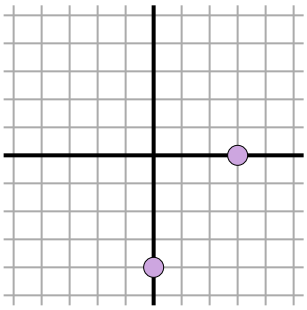

$\sqrt{(0-3)^2 + (-4-0)^2}$

$\sqrt{(9) + (16)}$

4)

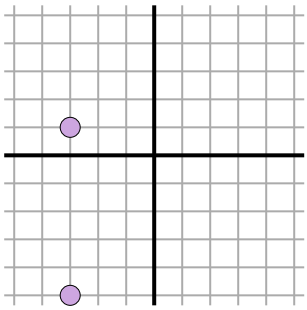

$\sqrt{(-3--3)^2 + (1--5)^2}$

$\sqrt{(0) + (36)}$

5)

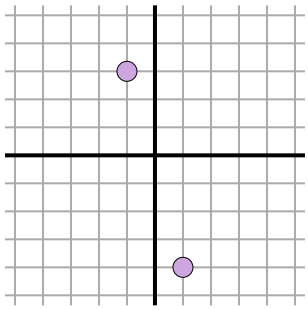

$\sqrt{(-1-1)^2 + (3--4)^2}$

$\sqrt{(4) + (49)}$

6)

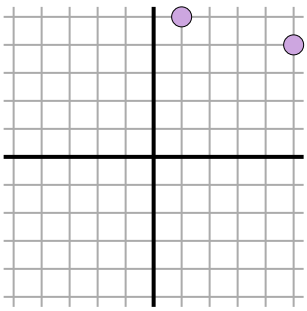

$\sqrt{(5-1)^2 + (4-5)^2}$

$\sqrt{(16) + (1)}$

7)

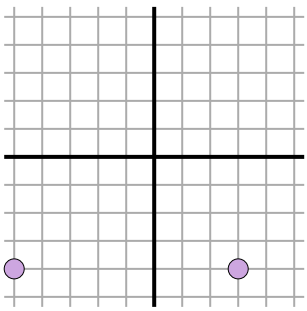

$\sqrt{(3--5)^2 + (-4--4)^2}$

$\sqrt{(64) + (0)}$

8)

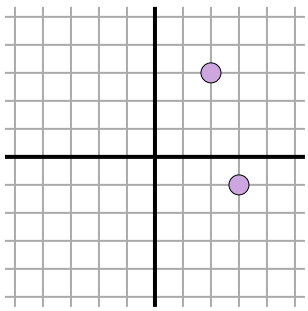

$\sqrt{(2-3)^2 + (3--1)^2}$

$\sqrt{(1) + (16)}$

9)

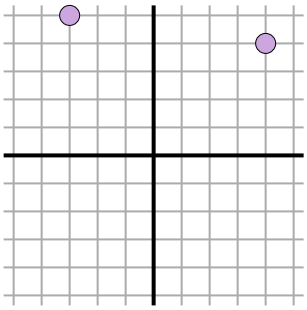

$\sqrt{(-3-4)^2 + (5-4)^2}$

$\sqrt{(49) + (1)}$

10)

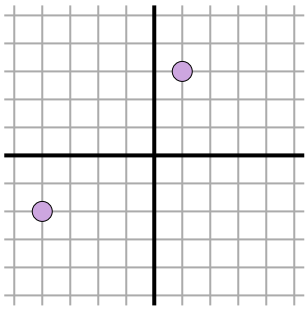

$\sqrt{(1--4)^2 + (3--2)^2}$

$\sqrt{(25) + (25)}$

11)

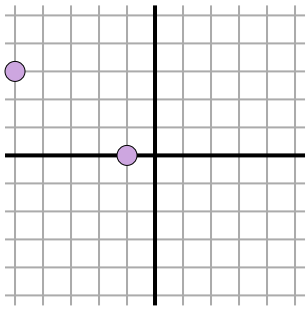

$\sqrt{(-5--1)^2 + (3-0)^2}$

$\sqrt{(16) + (9)}$

Risposte

Es.	6,3
1.	4,5
2.	10
3.	5
4.	6
5.	7,3
6.	4,1
7.	8
8.	4,1
9.	7,1
10.	7,1
11.	5