Trova la distante sulla griglia

Nome:

Trova la distanza tra i punti. Arrotonda il risultato alla decina più vicina.

Es)

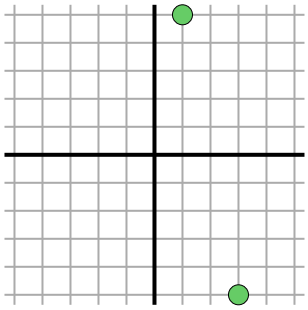

$\sqrt{(1-3)^2 + (5--5)^2}$

$\sqrt{(4) + (100)}$

1)

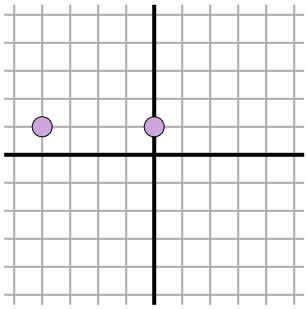

2)

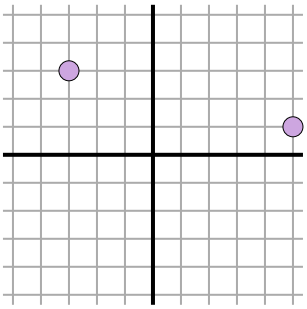

3)

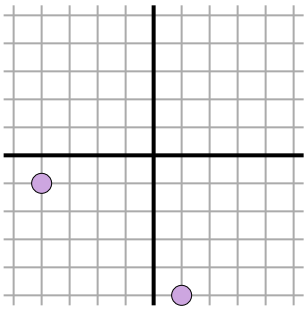

4)

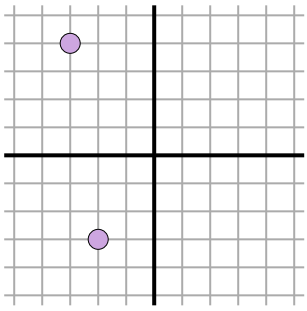

5)

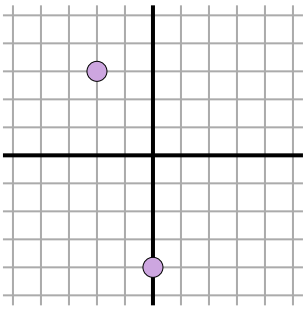

6)

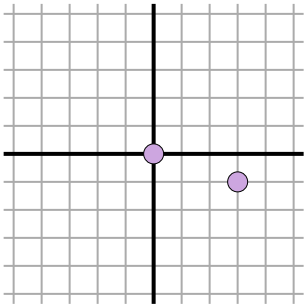

7)

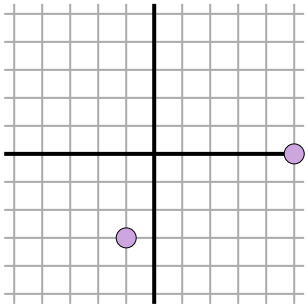

8)

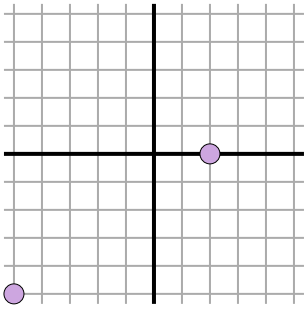

9)

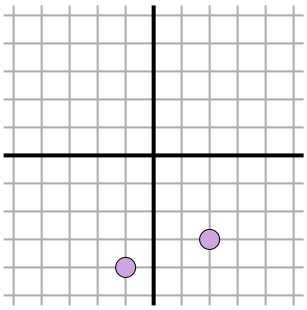

10)

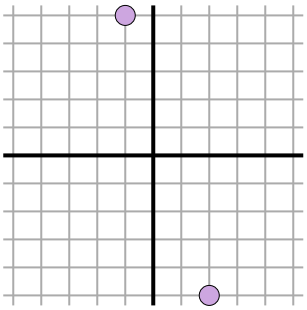

11)

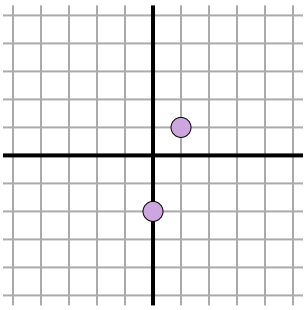

Risposte

Es. 10,2

1. _____
2. _____
3. _____
4. _____
5. _____
6. _____
7. _____
8. _____
9. _____
10. _____
11. _____

Trova la distante sulla griglia

Nome: **Soluzioni**

Trova la distanza tra i punti. Arrotonda il risultato alla decina più vicina.

Es)

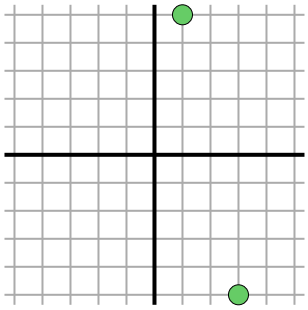

$\sqrt{(1-3)^2 + (5--5)^2}$

$\sqrt{(4) + (100)}$

1)

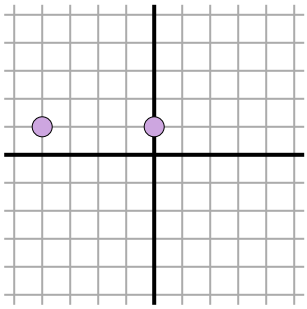

$\sqrt{(-4-0)^2 + (1-1)^2}$

$\sqrt{(16) + (0)}$

2)

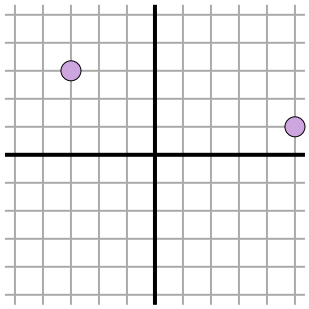

$\sqrt{(-3-5)^2 + (3-1)^2}$

$\sqrt{(64) + (4)}$

3)

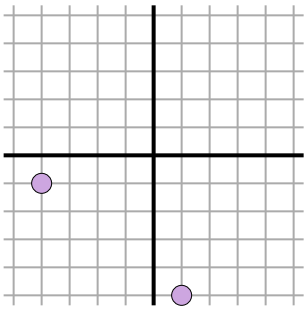

$\sqrt{(-4-1)^2 + (-1--5)^2}$

$\sqrt{(25) + (16)}$

4)

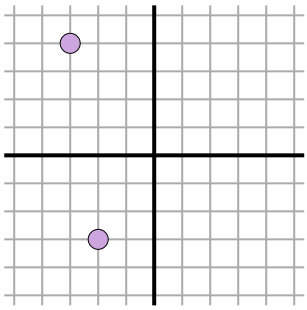

$\sqrt{(-2--3)^2 + (-3-4)^2}$

$\sqrt{(1) + (49)}$

5)

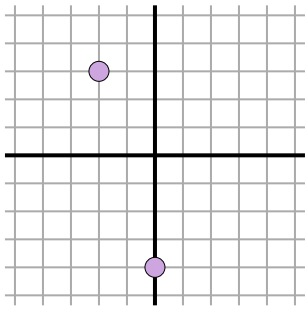

$\sqrt{(0--2)^2 + (-4-3)^2}$

$\sqrt{(4) + (49)}$

6)

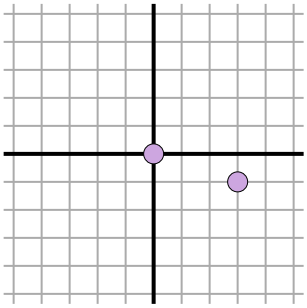

$\sqrt{(3-0)^2 + (-1-0)^2}$

$\sqrt{(9) + (1)}$

7)

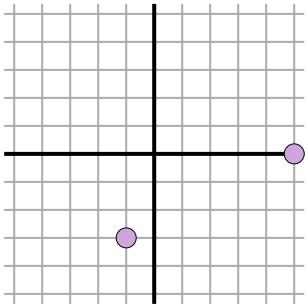

$\sqrt{(5--1)^2 + (0--3)^2}$

$\sqrt{(36) + (9)}$

8)

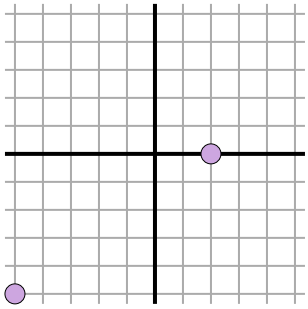

$\sqrt{(2--5)^2 + (0--5)^2}$

$\sqrt{(49) + (25)}$

9)

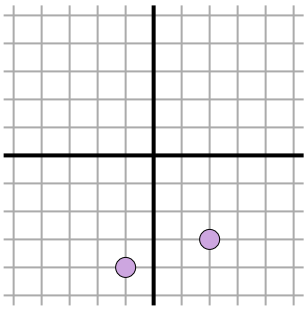

$\sqrt{(2--1)^2 + (-3--4)^2}$

$\sqrt{(9) + (1)}$

10)

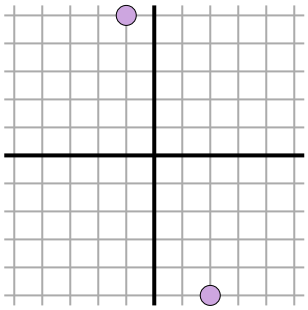

$\sqrt{(2--1)^2 + (-5-5)^2}$

$\sqrt{(9) + (100)}$

11)

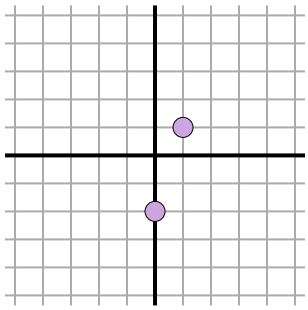

$\sqrt{(1-0)^2 + (1--2)^2}$

$\sqrt{(1) + (9)}$

Risposte

Es.	10,2
1.	4
2.	8,2
3.	6,4
4.	7,1
5.	7,3
6.	3,2
7.	6,7
8.	8,6
9.	3,2
10.	10,4
11.	3,2