Trova la distante sulla griglia

Nome:

Trova la distanza tra i punti. Arrotonda il risultato alla decina più vicina.

Es)

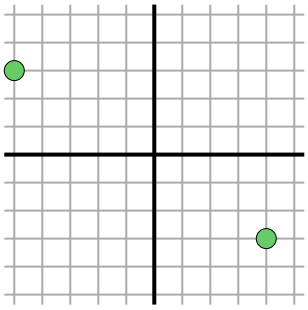

$\sqrt{(-5-4)^2 + (3--3)^2}$

$\sqrt{(81) + (36)}$

1)

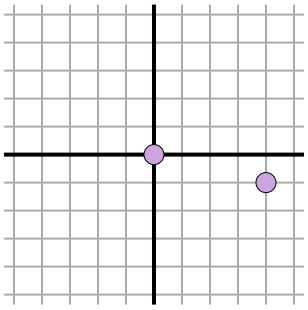

2)

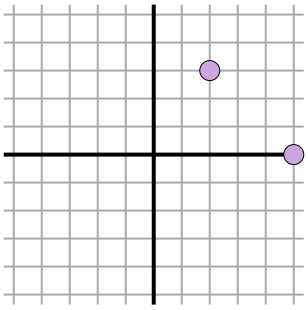

3)

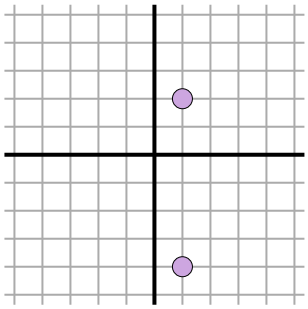

4)

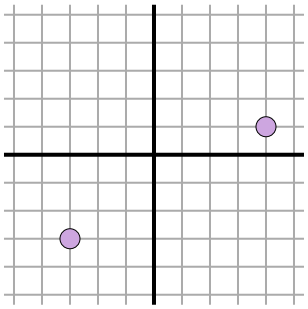

5)

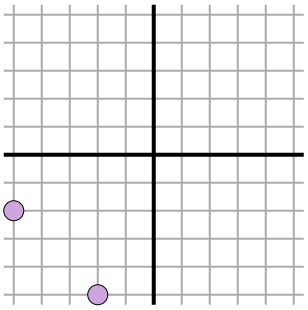

6)

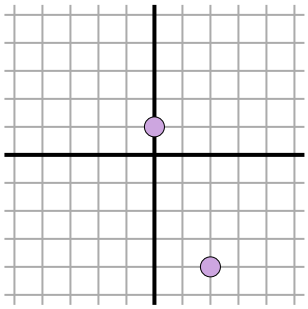

7)

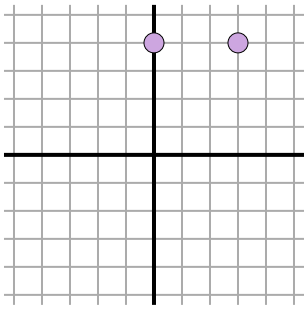

8)

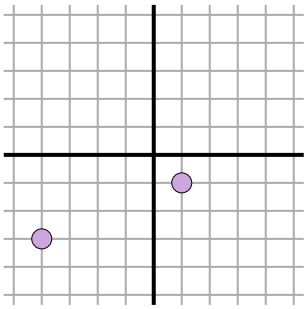

9)

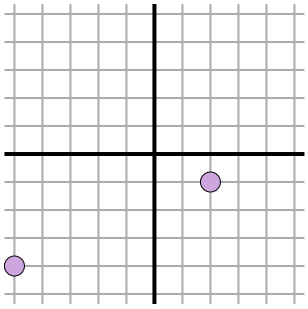

10)

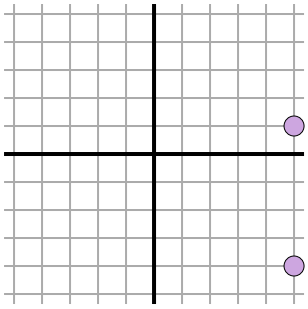

11)

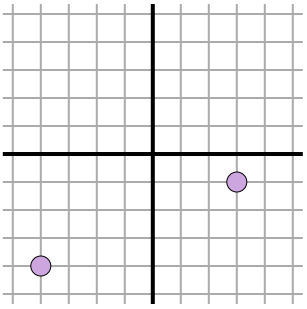

Risposte

Es. 10,8

1. _____

2. _____

3. _____

4. _____

5. _____

6. _____

7. _____

8. _____

9. _____

10. _____

11. _____

1-10	91	82	73	64	55	45	36	27	18	9
11	0									

Trova la distante sulla griglia

Nome: **Soluzioni**

Trova la distanza tra i punti. Arrotonda il risultato alla decina più vicina.

Es)

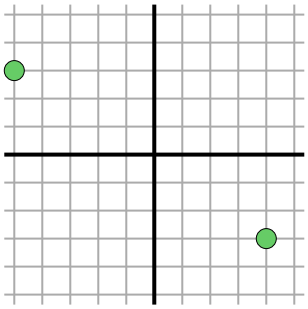

$\sqrt{(-5-4)^2 + (3--3)^2}$

$\sqrt{(81) + (36)}$

1)

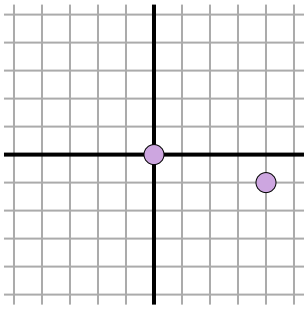

$\sqrt{(0-4)^2 + (0--1)^2}$

$\sqrt{(16) + (1)}$

2)

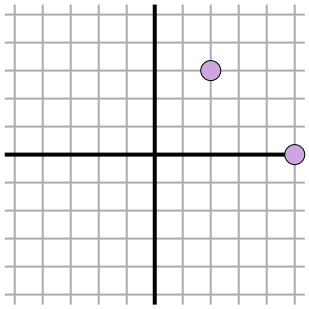

$\sqrt{(2-5)^2 + (3-0)^2}$

$\sqrt{(9) + (9)}$

3)

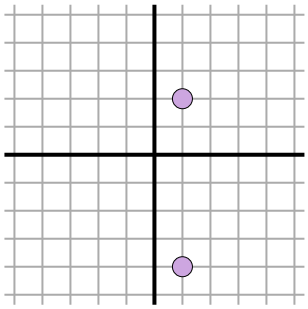

$\sqrt{(1-1)^2 + (2--4)^2}$

$\sqrt{(0) + (36)}$

4)

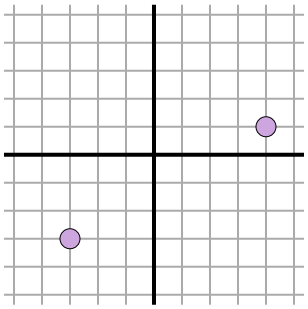

$\sqrt{(-3-4)^2 + (-3-1)^2}$

$\sqrt{(49) + (16)}$

5)

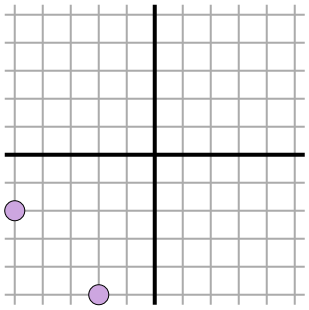

$\sqrt{(-2--5)^2 + (-5--2)^2}$

$\sqrt{(9) + (9)}$

6)

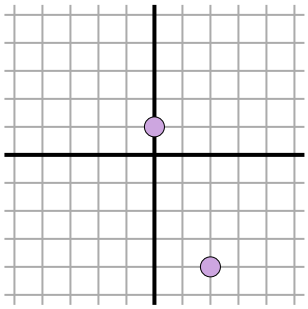

$\sqrt{(0-2)^2 + (1--4)^2}$

$\sqrt{(4) + (25)}$

7)

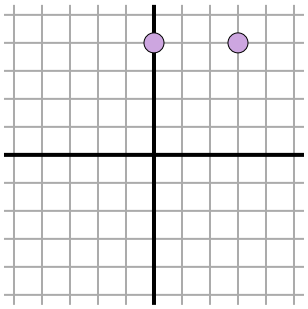

$\sqrt{(0-3)^2 + (4-4)^2}$

$\sqrt{(9) + (0)}$

8)

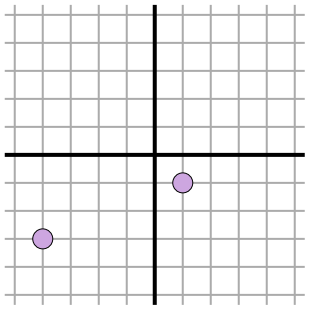

$\sqrt{(1--4)^2 + (-1--3)^2}$

$\sqrt{(25) + (4)}$

9)

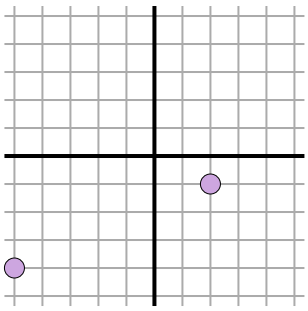

$\sqrt{(2--5)^2 + (-1--4)^2}$

$\sqrt{(49) + (9)}$

10)

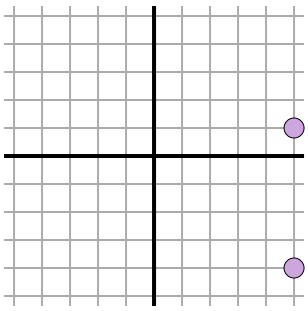

$\sqrt{(5-5)^2 + (-4-1)^2}$

$\sqrt{(0) + (25)}$

11)

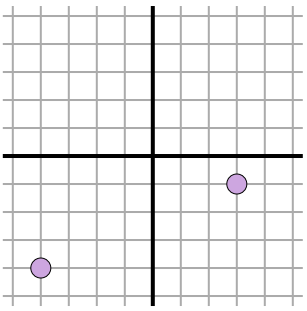

$\sqrt{(-4-3)^2 + (-4--1)^2}$

$\sqrt{(49) + (9)}$

Risposte

Es.	10,8
1.	4,1
2.	4,2
3.	6
4.	8,1
5.	4,2
6.	5,4
7.	3
8.	5,4
9.	7,6
10.	5
11.	7,6

1-10	91	82	73	64	55	45	36	27	18	9
11	0									