Trova la distante sulla griglia

Nome:

Trova la distanza tra i punti. Arrotonda il risultato alla decina più vicina.

Es)

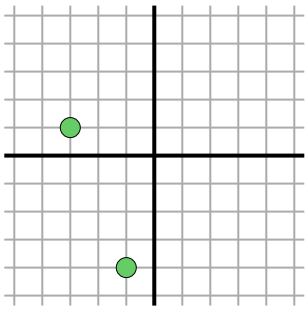

$\sqrt{(-3--1)^2 + (1--4)^2}$

$\sqrt{(4) + (25)}$

1)

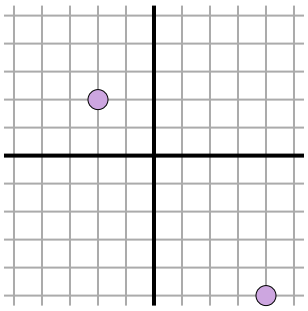

2)

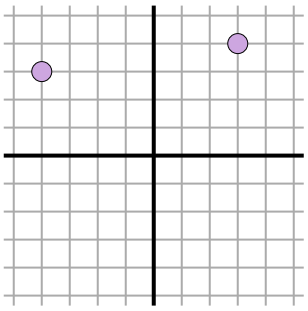

3)

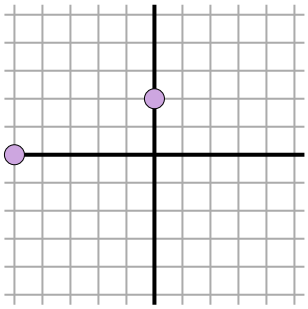

4)

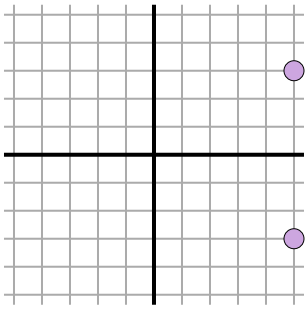

5)

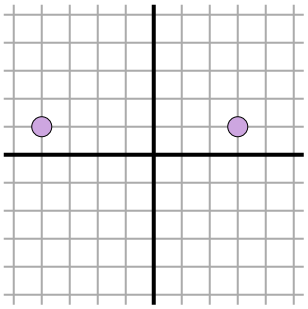

6)

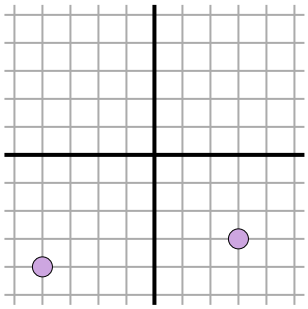

7)

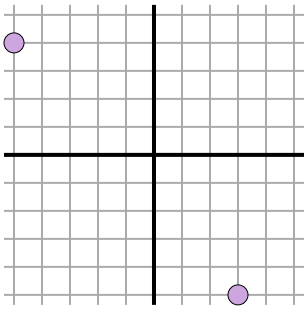

8)

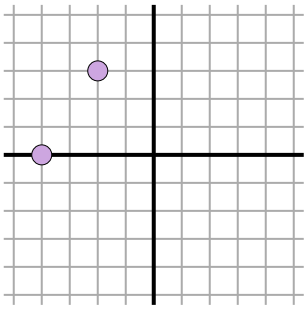

9)

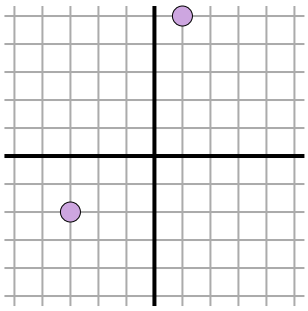

10)

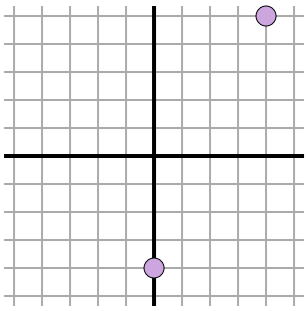

11)

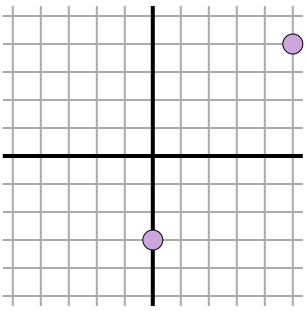

Risposte

Es. 5,4

1. _____
2. _____
3. _____
4. _____
5. _____
6. _____
7. _____
8. _____
9. _____
10. _____
11. _____

1-10	91	82	73	64	55	45	36	27	18	9
11	0									

Trova la distante sulla griglia

Nome: **Soluzioni**

Trova la distanza tra i punti. Arrotonda il risultato alla decina più vicina.

Es)

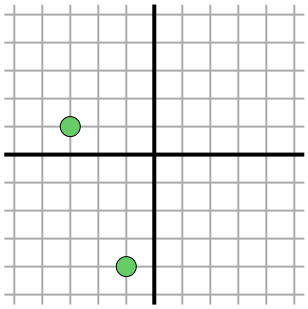

$\sqrt{(-3--1)^2 + (1--4)^2}$

$\sqrt{(4) + (25)}$

1)

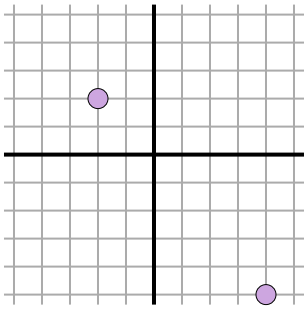

$\sqrt{(4--2)^2 + (-5-2)^2}$

$\sqrt{(36) + (49)}$

2)

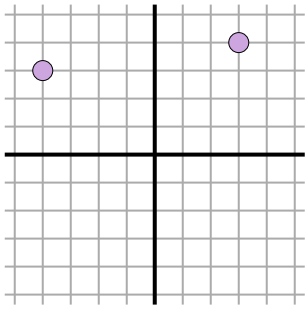

$\sqrt{(3--4)^2 + (4-3)^2}$

$\sqrt{(49) + (1)}$

3)

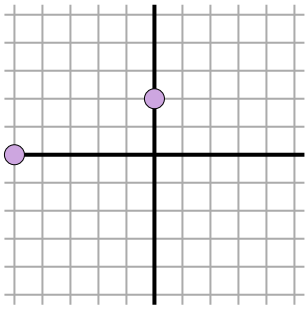

$\sqrt{(-5-0)^2 + (0-2)^2}$

$\sqrt{(25) + (4)}$

4)

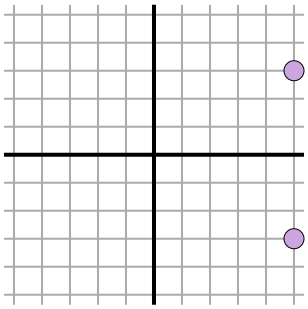

$\sqrt{(5-5)^2 + (3--3)^2}$

$\sqrt{(0) + (36)}$

5)

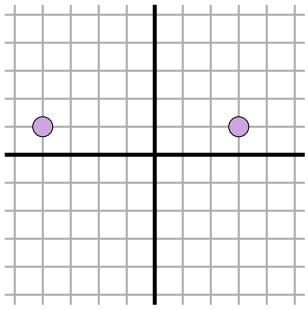

$\sqrt{(3--4)^2 + (1-1)^2}$

$\sqrt{(49) + (0)}$

6)

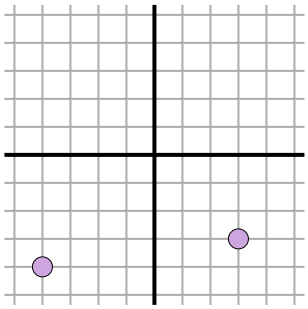

$\sqrt{(-4-3)^2 + (-4--3)^2}$

$\sqrt{(49) + (1)}$

7)

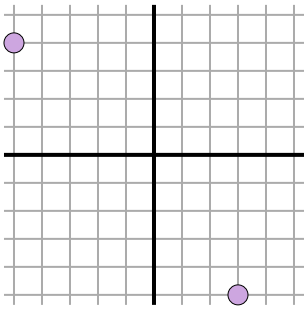

$\sqrt{(-5-3)^2 + (4--5)^2}$

$\sqrt{(64) + (81)}$

8)

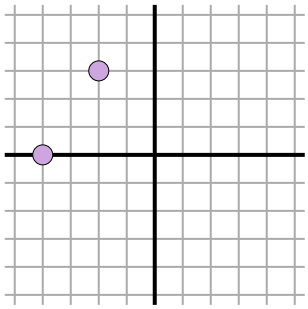

$\sqrt{(-2--4)^2 + (3-0)^2}$

$\sqrt{(4) + (9)}$

9)

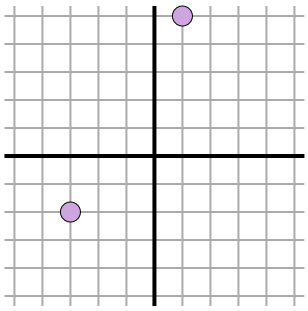

$\sqrt{(1--3)^2 + (5--2)^2}$

$\sqrt{(16) + (49)}$

10)

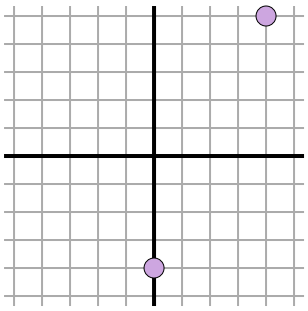

$\sqrt{(4-0)^2 + (5--4)^2}$

$\sqrt{(16) + (81)}$

11)

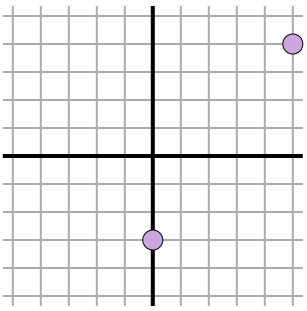

$\sqrt{(5-0)^2 + (4--3)^2}$

$\sqrt{(25) + (49)}$

Risposte

Es.	5,4
1.	9,2
2.	7,1
3.	5,4
4.	6
5.	7
6.	7,1
7.	12
8.	3,6
9.	8,1
10.	9,8
11.	8,6

1-10	91	82	73	64	55	45	36	27	18	9
11	0									