Trova la distante sulla griglia

Nome:

Trova la distanza tra i punti. Arrotonda il risultato alla decina più vicina.

Es)

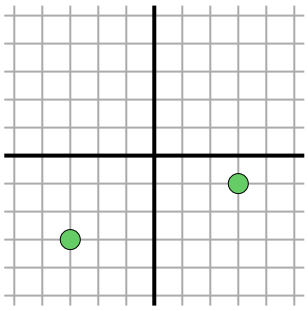

$\sqrt{(-3-3)^2 + (-3--1)^2}$

$\sqrt{(36) + (4)}$

1)

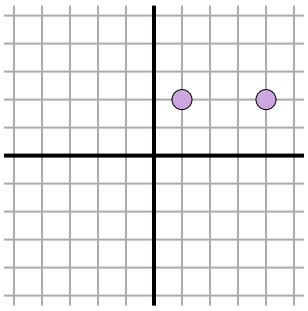

2)

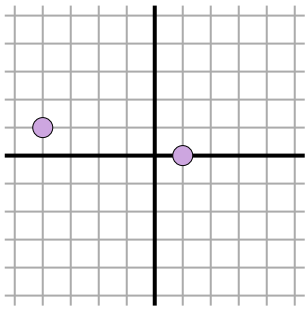

3)

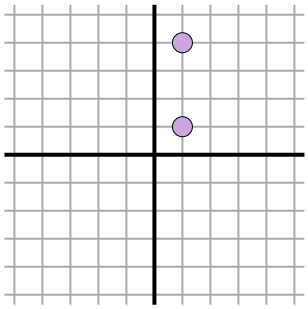

4)

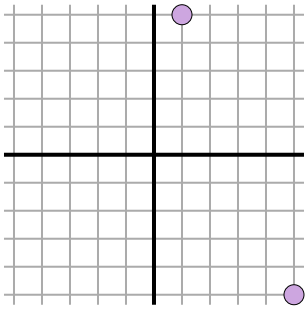

5)

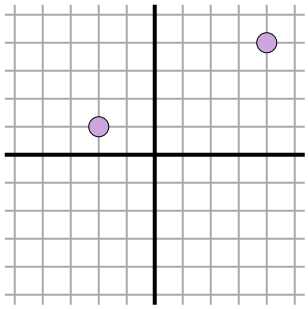

6)

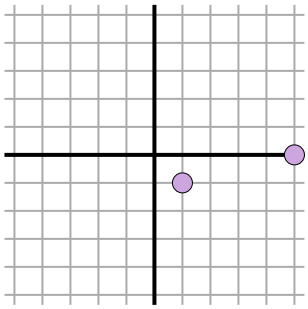

7)

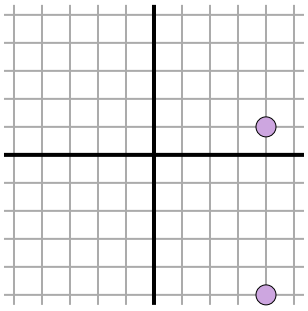

8)

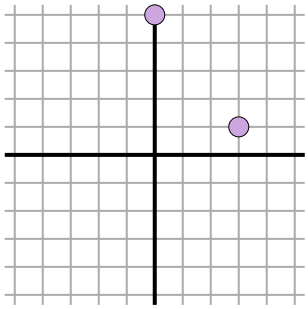

9)

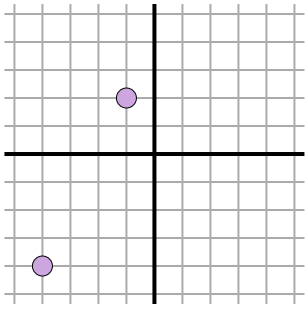

10)

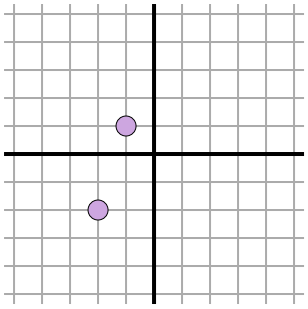

11)

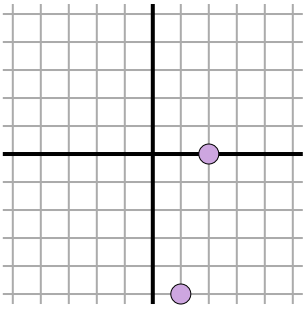

Risposte

Es. 6,3

1. _____
2. _____
3. _____
4. _____
5. _____
6. _____
7. _____
8. _____
9. _____
10. _____
11. _____

1-10	91	82	73	64	55	45	36	27	18	9
11	0									

Trova la distante sulla griglia

Nome: **Soluzioni**

Trova la distanza tra i punti. Arrotonda il risultato alla decina più vicina.

Es)

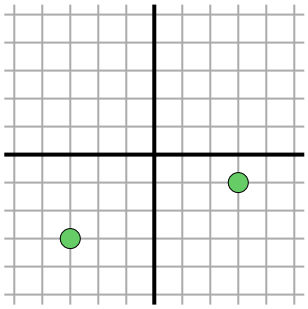

$\sqrt{(-3-3)^2 + (-3--1)^2}$

$\sqrt{(36) + (4)}$

1)

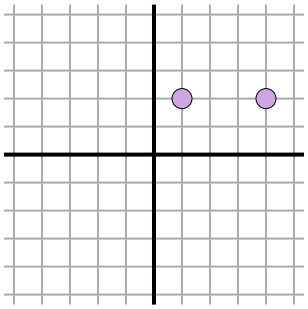

$\sqrt{(1-4)^2 + (2-2)^2}$

$\sqrt{(9) + (0)}$

2)

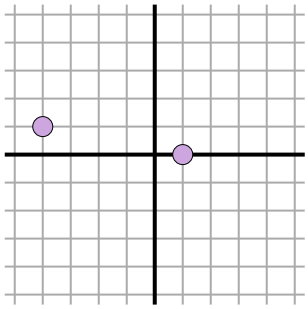

$\sqrt{(-4-1)^2 + (1-0)^2}$

$\sqrt{(25) + (1)}$

3)

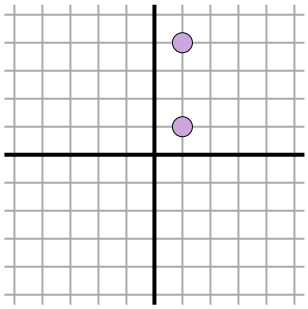

$\sqrt{(1-1)^2 + (4-1)^2}$

$\sqrt{(0) + (9)}$

4)

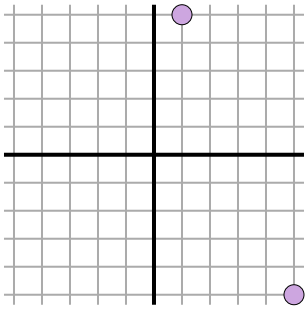

$\sqrt{(5-1)^2 + (-5-5)^2}$

$\sqrt{(16) + (100)}$

5)

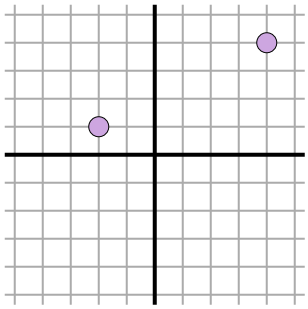

$\sqrt{(4--2)^2 + (4-1)^2}$

$\sqrt{(36) + (9)}$

6)

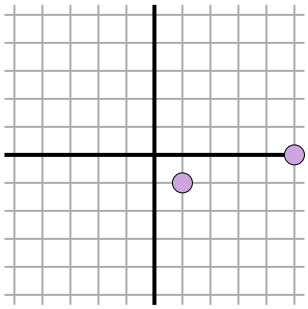

$\sqrt{(5-1)^2 + (0--1)^2}$

$\sqrt{(16) + (1)}$

7)

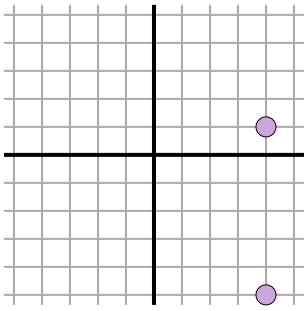

$\sqrt{(4-4)^2 + (-5-1)^2}$

$\sqrt{(0) + (36)}$

8)

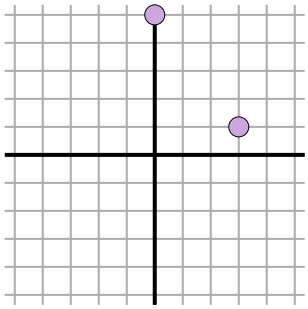

$\sqrt{(3-0)^2 + (1-5)^2}$

$\sqrt{(9) + (16)}$

9)

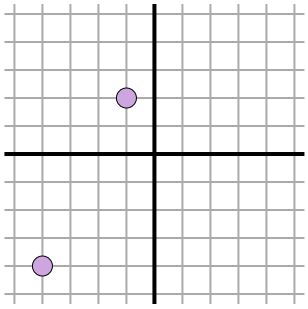

$\sqrt{(-4--1)^2 + (-4-2)^2}$

$\sqrt{(9) + (36)}$

10)

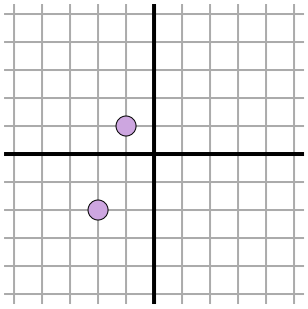

$\sqrt{(-2--1)^2 + (-2-1)^2}$

$\sqrt{(1) + (9)}$

11)

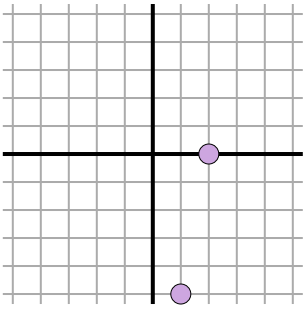

$\sqrt{(1-2)^2 + (-5-0)^2}$

$\sqrt{(1) + (25)}$

Risposte

Es.	6,3
1.	3
2.	5,1
3.	3
4.	10,8
5.	6,7
6.	4,1
7.	6
8.	5
9.	6,7
10.	3,2
11.	5,1

1-10	91	82	73	64	55	45	36	27	18	9
11	0									