Trova la distante sulla griglia

Nome:

Trova la distanza tra i punti. Arrotonda il risultato alla decina più vicina.

Es)

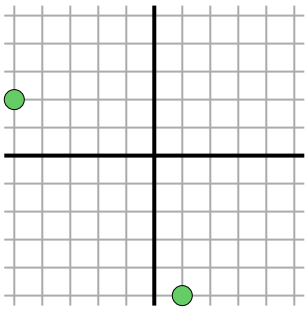

$\sqrt{(1--5)^2 + (-5-2)^2}$

$\sqrt{(36) + (49)}$

1)

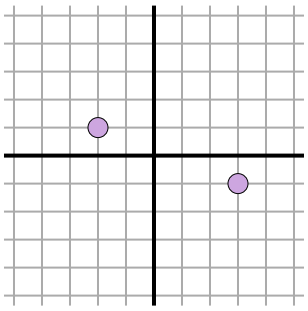

2)

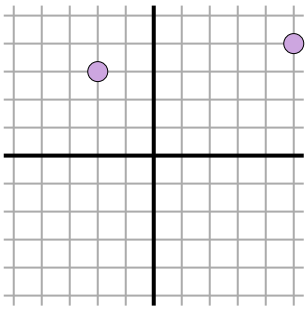

3)

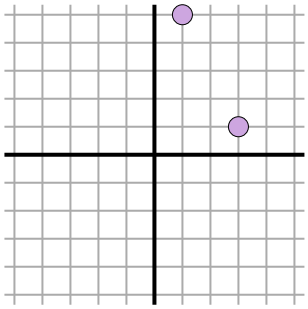

4)

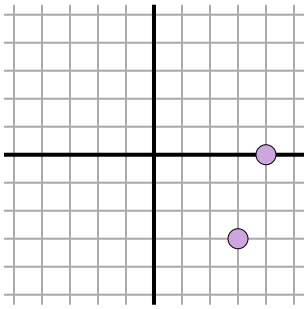

5)

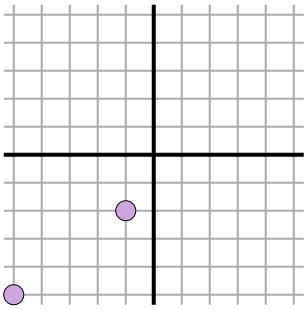

6)

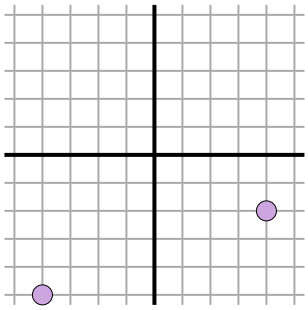

7)

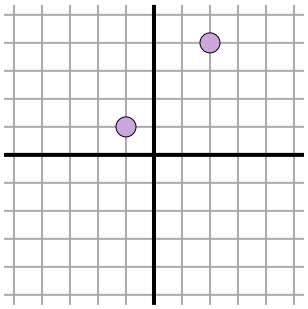

8)

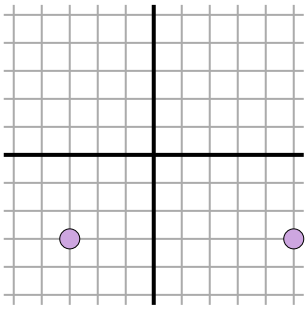

9)

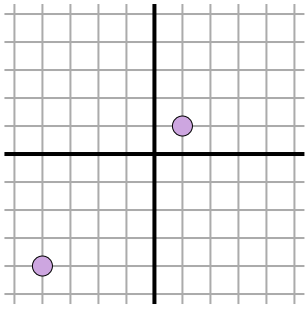

10)

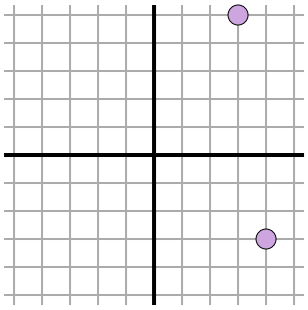

11)

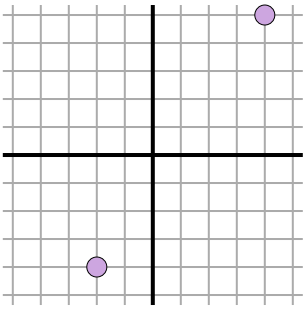

Risposte

Es. 9,2

1. _____
2. _____
3. _____
4. _____
5. _____
6. _____
7. _____
8. _____
9. _____
10. _____
11. _____

1-10	91	82	73	64	55	45	36	27	18	9
11	0									

Trova la distante sulla griglia

Nome: **Soluzioni**

Trova la distanza tra i punti. Arrotonda il risultato alla decina più vicina.

Es)

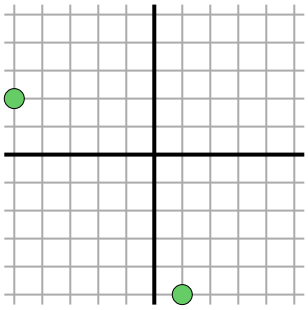

$\sqrt{(1--5)^2 + (-5-2)^2}$

$\sqrt{(36) + (49)}$

1)

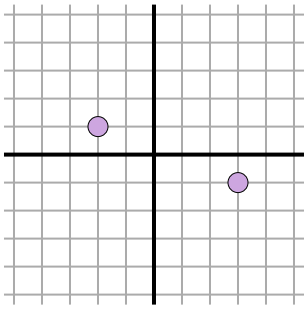

$\sqrt{(3--2)^2 + (-1-1)^2}$

$\sqrt{(25) + (4)}$

2)

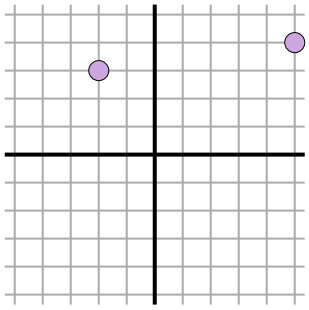

$\sqrt{(-2-5)^2 + (3-4)^2}$

$\sqrt{(49) + (1)}$

3)

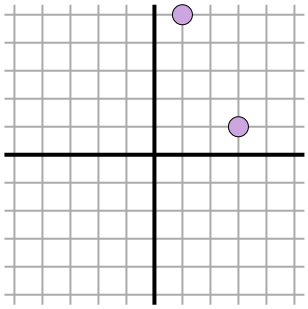

$\sqrt{(3-1)^2 + (1-5)^2}$

$\sqrt{(4) + (16)}$

4)

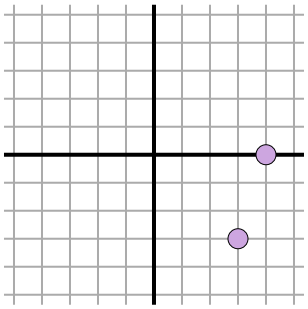

$\sqrt{(3-4)^2 + (-3-0)^2}$

$\sqrt{(1) + (9)}$

5)

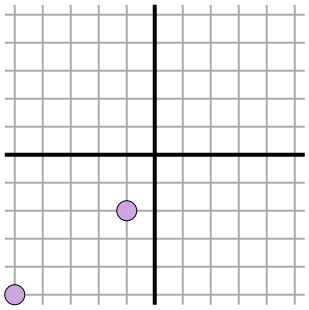

$\sqrt{(-1--5)^2 + (-2--5)^2}$

$\sqrt{(16) + (9)}$

6)

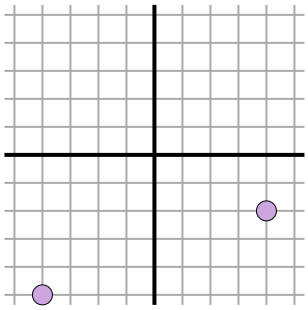

$\sqrt{(4--4)^2 + (-2--5)^2}$

$\sqrt{(64) + (9)}$

7)

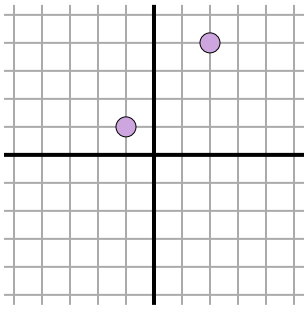

$\sqrt{(2--1)^2 + (4-1)^2}$

$\sqrt{(9) + (9)}$

8)

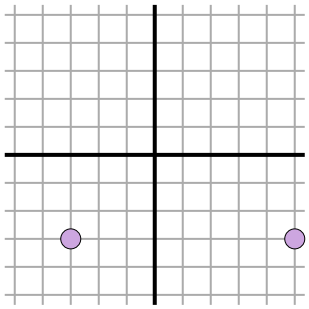

$\sqrt{(5--3)^2 + (-3--3)^2}$

$\sqrt{(64) + (0)}$

9)

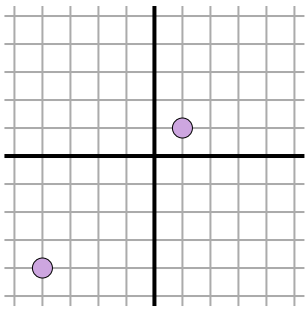

$\sqrt{(-4-1)^2 + (-4-1)^2}$

$\sqrt{(25) + (25)}$

10)

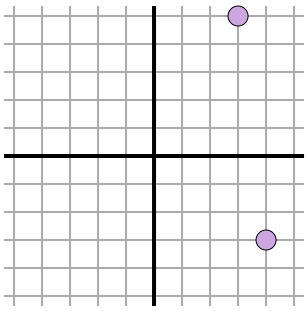

$\sqrt{(4-3)^2 + (-3-5)^2}$

$\sqrt{(1) + (64)}$

11)

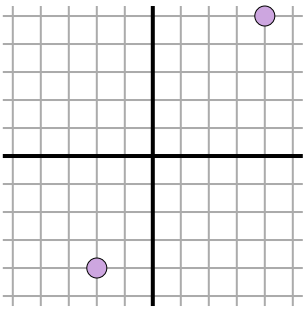

$\sqrt{(-2-4)^2 + (-4-5)^2}$

$\sqrt{(36) + (81)}$

Risposte

Es.	9,2
1.	5,4
2.	7,1
3.	4,5
4.	3,2
5.	5
6.	8,5
7.	4,2
8.	8
9.	7,1
10.	8,1
11.	10,8

1-10	91	82	73	64	55	45	36	27	18	9
11	0									