Trova la distante sulla griglia

Nome:

Trova la distanza tra i punti. Arrotonda il risultato alla decina più vicina.

Es)

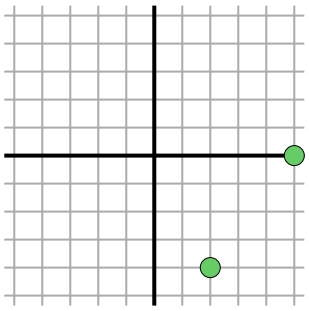

$\sqrt{(2-5)^2 + (-4-0)^2}$

$\sqrt{(9) + (16)}$

1)

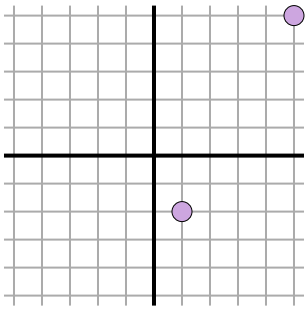

2)

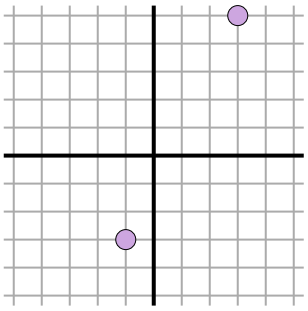

3)

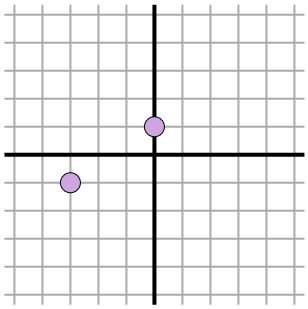

4)

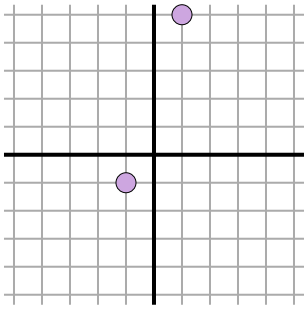

5)

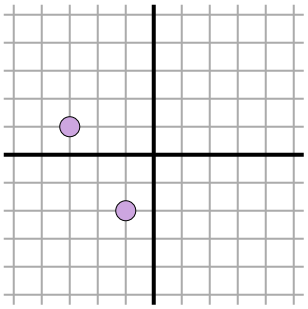

6)

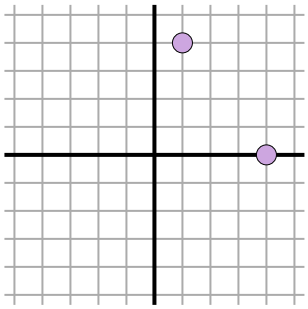

7)

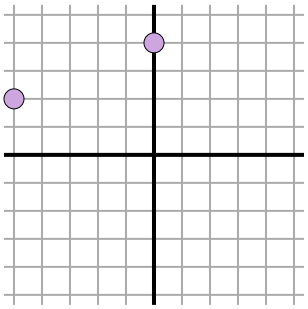

8)

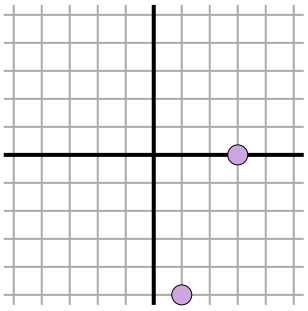

9)

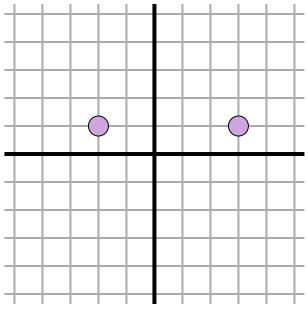

10)

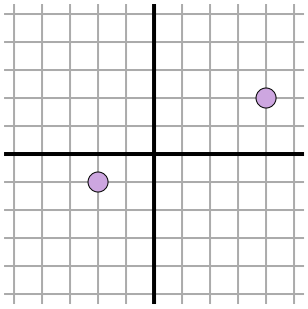

11)

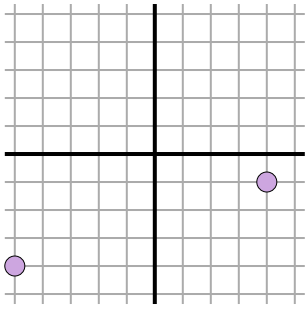

Risposte

Es. 5

1. _____
2. _____
3. _____
4. _____
5. _____
6. _____
7. _____
8. _____
9. _____
10. _____
11. _____

1-10	91	82	73	64	55	45	36	27	18	9
11	0									

Trova la distante sulla griglia

Nome: **Soluzioni**

Trova la distanza tra i punti. Arrotonda il risultato alla decina più vicina.

Es)

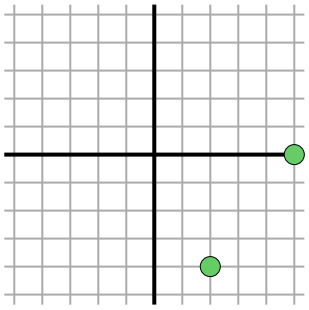

$\sqrt{(2-5)^2 + (-4-0)^2}$

$\sqrt{(9) + (16)}$

1)

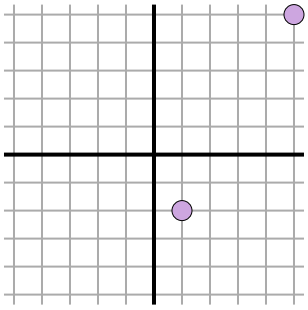

$\sqrt{(1-5)^2 + (-2-5)^2}$

$\sqrt{(16) + (49)}$

2)

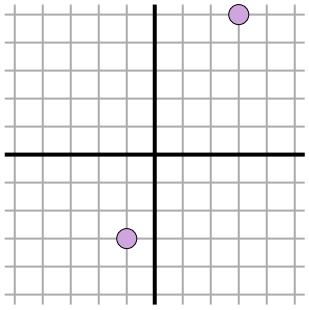

$\sqrt{(-1-3)^2 + (-3-5)^2}$

$\sqrt{(16) + (64)}$

3)

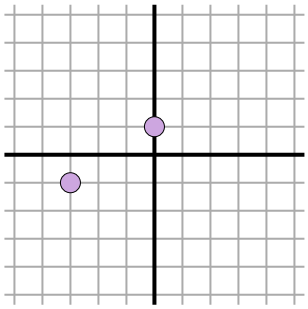

$\sqrt{(-3-0)^2 + (-1-1)^2}$

$\sqrt{(9) + (4)}$

4)

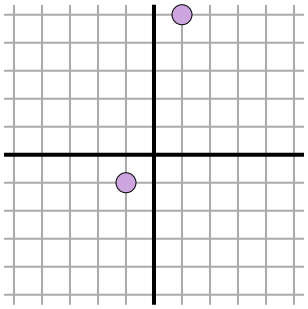

$\sqrt{(1--1)^2 + (5--1)^2}$

$\sqrt{(4) + (36)}$

5)

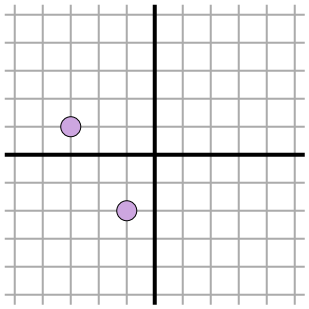

$\sqrt{(-1--3)^2 + (-2-1)^2}$

$\sqrt{(4) + (9)}$

6)

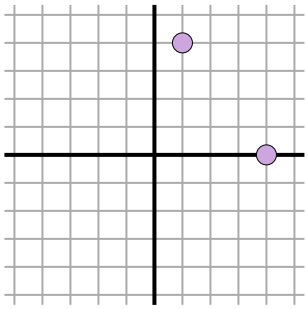

$\sqrt{(4-1)^2 + (0-4)^2}$

$\sqrt{(9) + (16)}$

7)

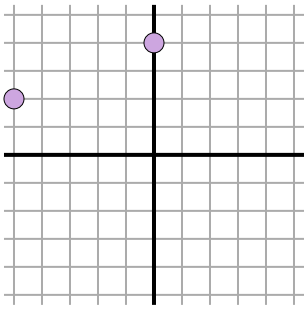

$\sqrt{(-5-0)^2 + (2-4)^2}$

$\sqrt{(25) + (4)}$

8)

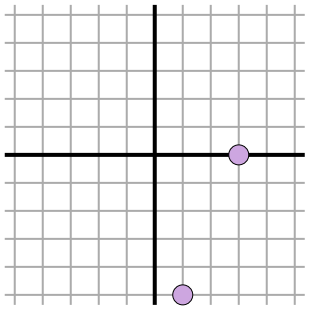

$\sqrt{(3-1)^2 + (0--5)^2}$

$\sqrt{(4) + (25)}$

9)

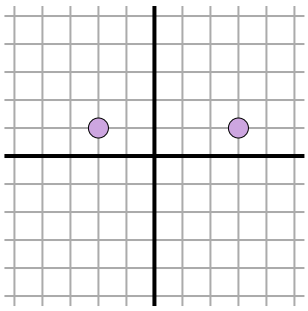

$\sqrt{(3--2)^2 + (1-1)^2}$

$\sqrt{(25) + (0)}$

10)

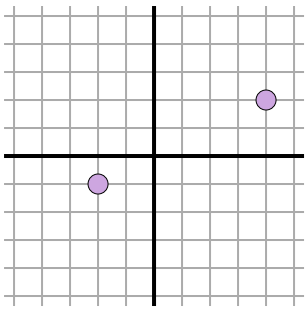

$\sqrt{(4--2)^2 + (2--1)^2}$

$\sqrt{(36) + (9)}$

11)

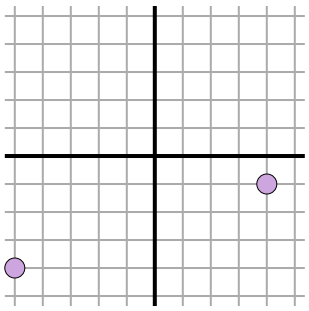

$\sqrt{(4--5)^2 + (-1--4)^2}$

$\sqrt{(81) + (9)}$

Risposte

Es.	5
1.	8,1
2.	8,9
3.	3,6
4.	6,3
5.	3,6
6.	5
7.	5,4
8.	5,4
9.	5
10.	6,7
11.	9,5

1-10	91	82	73	64	55	45	36	27	18	9
11	0									