Trova la distante sulla griglia

Nome:

Trova la distanza tra i punti. Arrotonda il risultato alla decina più vicina.

Es)

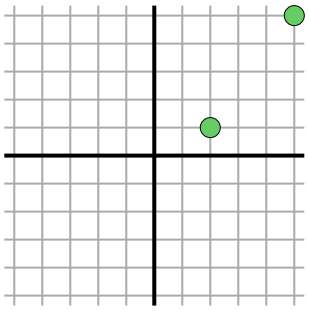

$\sqrt{(5-2)^2 + (5-1)^2}$

$\sqrt{(9) + (16)}$

1)

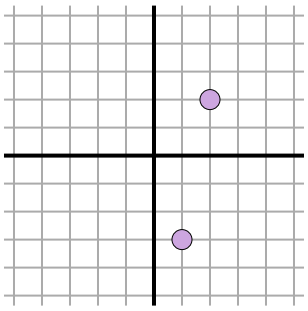

2)

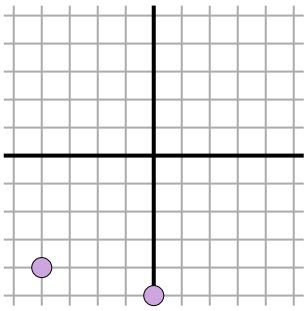

3)

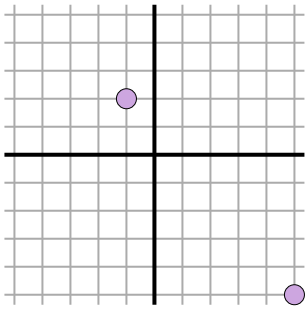

4)

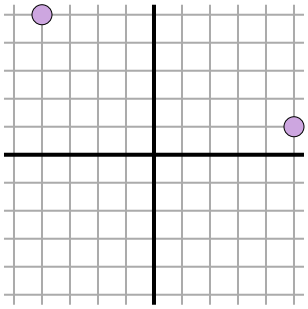

5)

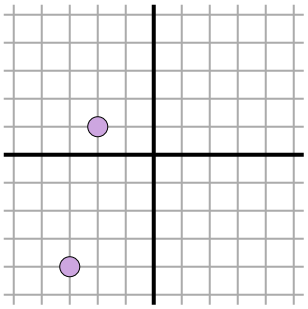

6)

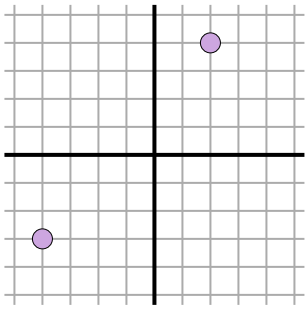

7)

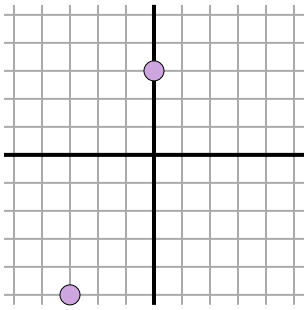

8)

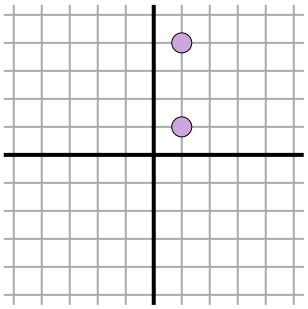

9)

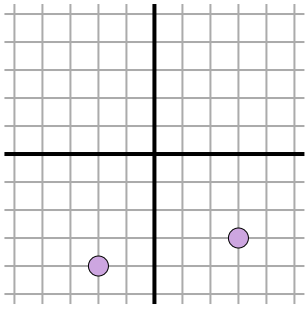

10)

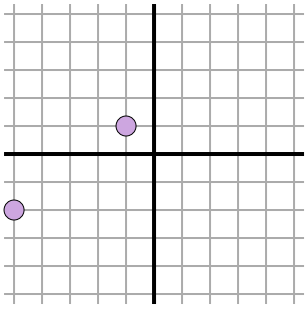

11)

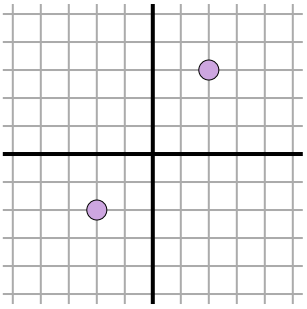

Risposte

Es. 5

1. _____
2. _____
3. _____
4. _____
5. _____
6. _____
7. _____
8. _____
9. _____
10. _____
11. _____

1-10	91	82	73	64	55	45	36	27	18	9
11	0									

Trova la distante sulla griglia

Nome: **Soluzioni**

Trova la distanza tra i punti. Arrotonda il risultato alla decina più vicina.

Es)

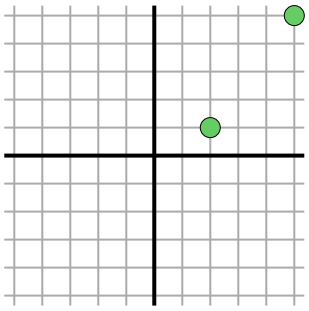

$\sqrt{(5-2)^2 + (5-1)^2}$

$\sqrt{(9) + (16)}$

1)

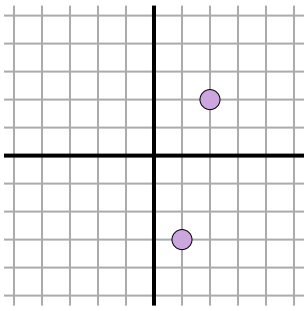

$\sqrt{(2-1)^2 + (2--3)^2}$

$\sqrt{(1) + (25)}$

2)

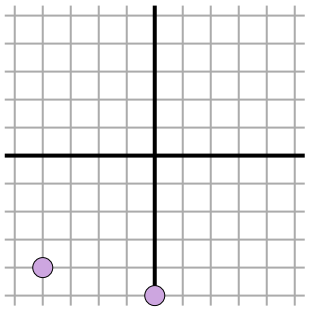

$\sqrt{(0--4)^2 + (-5--4)^2}$

$\sqrt{(16) + (1)}$

3)

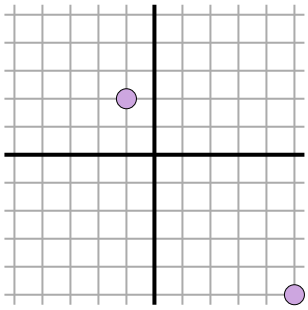

$\sqrt{(5--1)^2 + (-5-2)^2}$

$\sqrt{(36) + (49)}$

4)

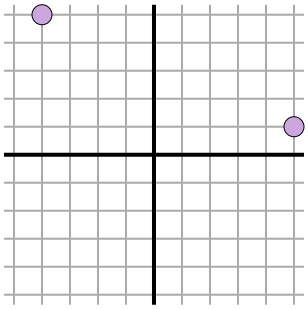

$\sqrt{(5--4)^2 + (1-5)^2}$

$\sqrt{(81) + (16)}$

5)

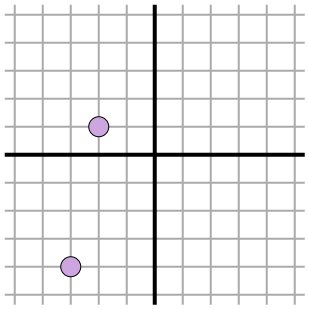

$\sqrt{(-3--2)^2 + (-4-1)^2}$

$\sqrt{(1) + (25)}$

6)

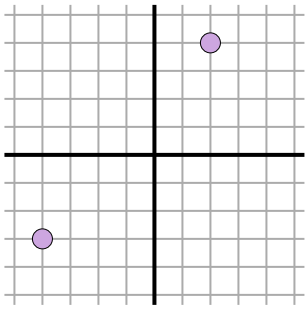

$\sqrt{(2--4)^2 + (4--3)^2}$

$\sqrt{(36) + (49)}$

7)

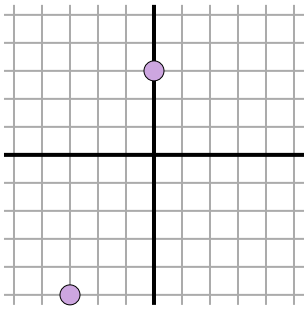

$\sqrt{(0--3)^2 + (3--5)^2}$

$\sqrt{(9) + (64)}$

8)

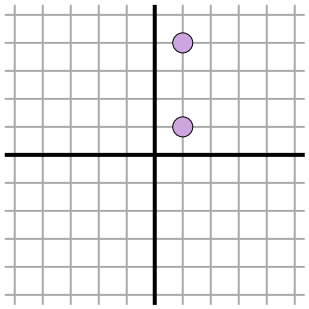

$\sqrt{(1-1)^2 + (4-1)^2}$

$\sqrt{(0) + (9)}$

9)

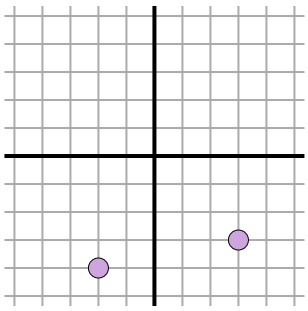

$\sqrt{(3--2)^2 + (-3--4)^2}$

$\sqrt{(25) + (1)}$

10)

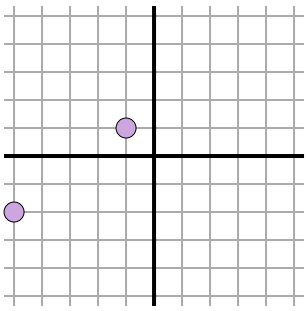

$\sqrt{(-5--1)^2 + (-2-1)^2}$

$\sqrt{(16) + (9)}$

11)

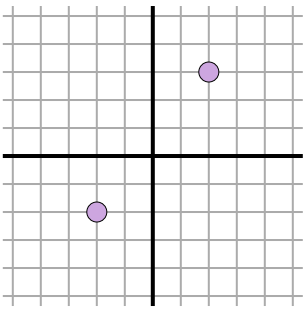

$\sqrt{(-2-2)^2 + (-2-3)^2}$

$\sqrt{(16) + (25)}$

Risposte

Es.	5
1.	5,1
2.	4,1
3.	9,2
4.	9,8
5.	5,1
6.	9,2
7.	8,5
8.	3
9.	5,1
10.	5
11.	6,4

1-10	91	82	73	64	55	45	36	27	18	9
11	0									