Trova la distante sulla griglia

Nome:

Trova la distanza tra i punti. Arrotonda il risultato alla decina più vicina.

Es)

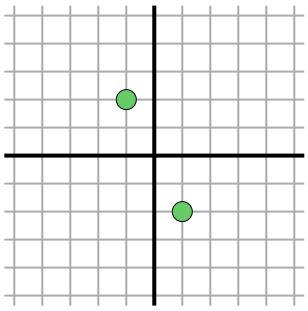

$\sqrt{(-1-1)^2 + (2--2)^2}$

$\sqrt{(4) + (16)}$

1)

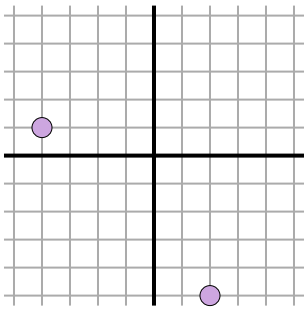

2)

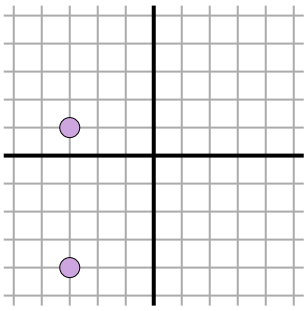

3)

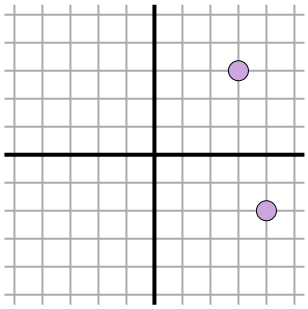

4)

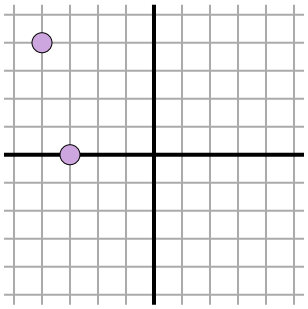

5)

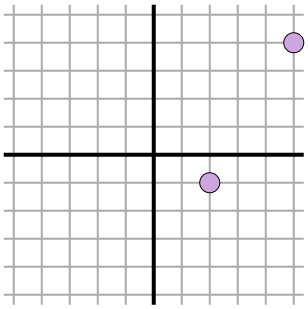

6)

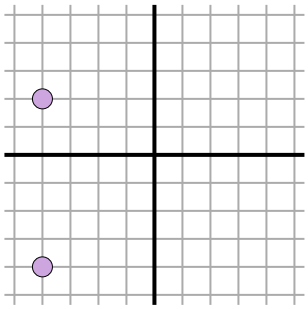

7)

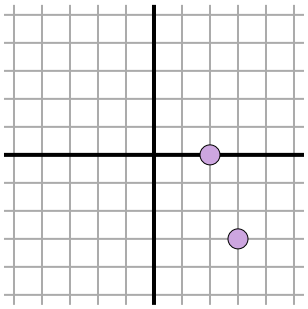

8)

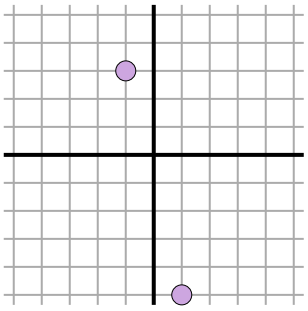

9)

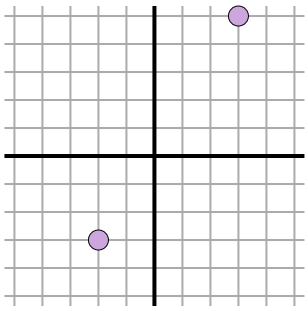

10)

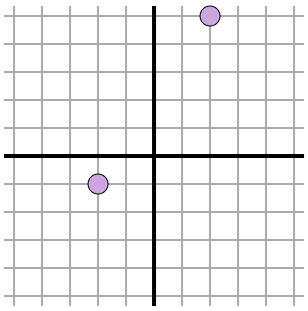

11)

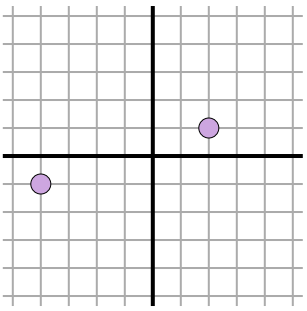

Risposte

Es. 4,5

1. _____

2. _____

3. _____

4. _____

5. _____

6. _____

7. _____

8. _____

9. _____

10. _____

11. _____

1-10	91	82	73	64	55	45	36	27	18	9
11	0									

Trova la distante sulla griglia

Nome: **Soluzioni**

Trova la distanza tra i punti. Arrotonda il risultato alla decina più vicina.

Es)

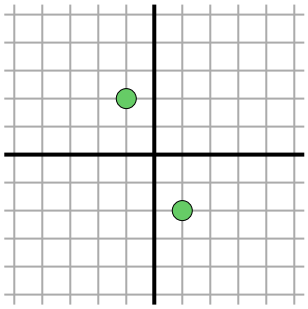

$\sqrt{(-1-1)^2 + (2--2)^2}$

$\sqrt{(4) + (16)}$

1)

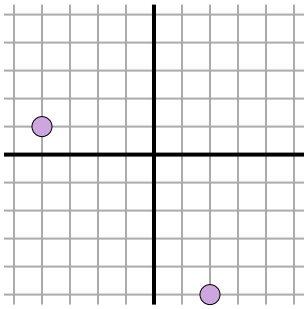

$\sqrt{(-4-2)^2 + (1--5)^2}$

$\sqrt{(36) + (36)}$

2)

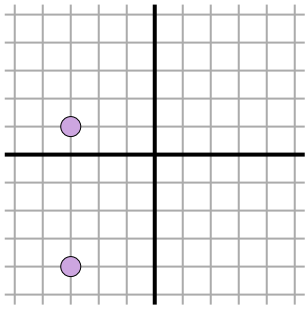

$\sqrt{(-3--3)^2 + (-4-1)^2}$

$\sqrt{(0) + (25)}$

3)

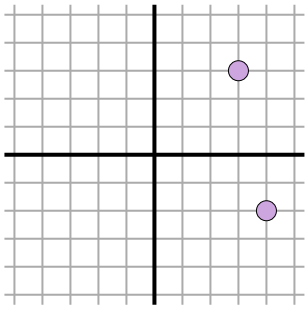

$\sqrt{(3-4)^2 + (3--2)^2}$

$\sqrt{(1) + (25)}$

4)

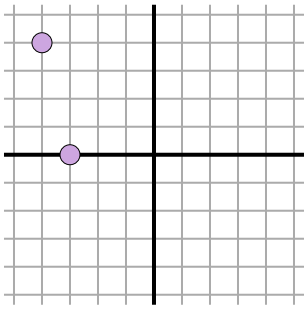

$\sqrt{(-3--4)^2 + (0-4)^2}$

$\sqrt{(1) + (16)}$

5)

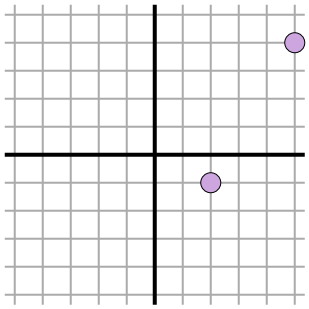

$\sqrt{(5-2)^2 + (4--1)^2}$

$\sqrt{(9) + (25)}$

6)

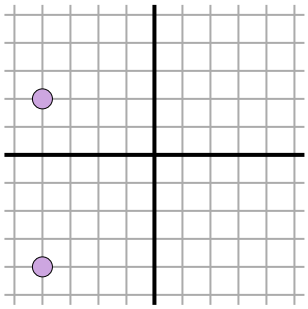

$\sqrt{(-4--4)^2 + (-4-2)^2}$

$\sqrt{(0) + (36)}$

7)

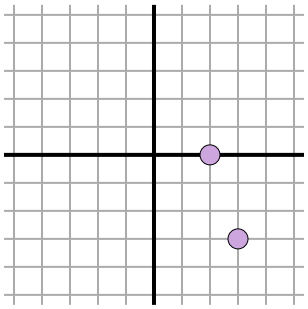

$\sqrt{(2-3)^2 + (0--3)^2}$

$\sqrt{(1) + (9)}$

8)

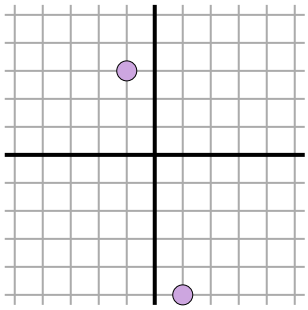

$\sqrt{(1--1)^2 + (-5-3)^2}$

$\sqrt{(4) + (64)}$

9)

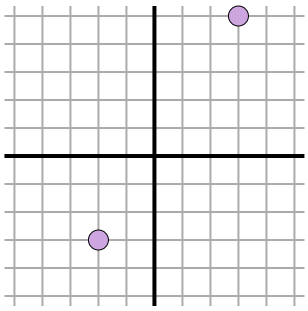

$\sqrt{(3--2)^2 + (5--3)^2}$

$\sqrt{(25) + (64)}$

10)

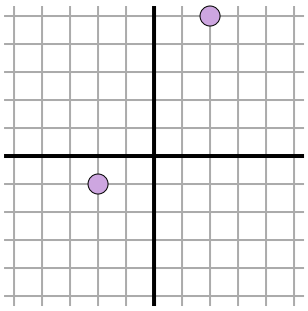

$\sqrt{(-2-2)^2 + (-1-5)^2}$

$\sqrt{(16) + (36)}$

11)

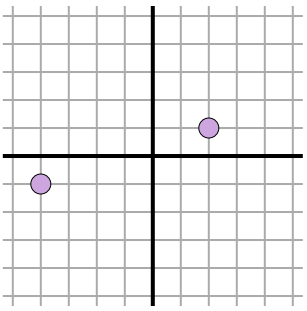

$\sqrt{(-4-2)^2 + (-1-1)^2}$

$\sqrt{(36) + (4)}$

Risposte

Es.	4,5
1.	8,5
2.	5
3.	5,1
4.	4,1
5.	5,8
6.	6
7.	3,2
8.	8,2
9.	9,4
10.	7,2
11.	6,3

1-10	91	82	73	64	55	45	36	27	18	9
11	0									