Moltiplicazioni con le frazioni (graficamente)

Nome:

Usa i quadrati per rappresentare la moltiplicazione indicata.

Es) $\frac{5}{7} \times \frac{2}{9} =$

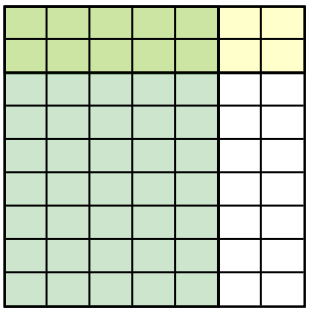

1) $\frac{3}{4} \times \frac{3}{7} =$

2) $\frac{1}{8} \times \frac{7}{9} =$

3) $\frac{1}{7} \times \frac{2}{7} =$

4) $\frac{2}{5} \times \frac{1}{4} =$

5) $\frac{5}{9} \times \frac{4}{6} =$

6) $\frac{1}{5} \times \frac{1}{3} =$

7) $\frac{3}{5} \times \frac{1}{3} =$

8) $\frac{1}{4} \times \frac{3}{5} =$

9) $\frac{1}{3} \times \frac{1}{2} =$

10) $\frac{2}{3} \times \frac{6}{8} =$

11) $\frac{1}{2} \times \frac{1}{2} =$

Risposte

Es. $\frac{10}{63}$

1. _____
2. _____
3. _____
4. _____
5. _____
6. _____
7. _____
8. _____
9. _____
10. _____
11. _____

Moltiplicazioni con le frazioni (graficamente) Nome: **Soluzioni**

Usa i quadrati per rappresentare la moltiplicazione indicata.

Es) $\frac{5}{7} \times \frac{2}{9} =$

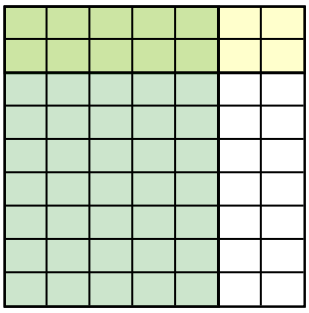

1) $\frac{3}{4} \times \frac{3}{7} =$

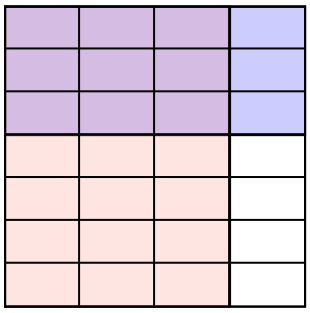

2) $\frac{1}{8} \times \frac{7}{9} =$

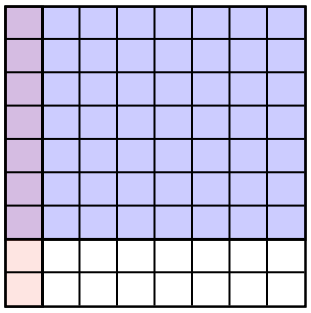

3) $\frac{1}{7} \times \frac{2}{7} =$

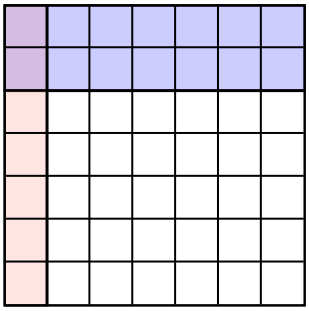

4) $\frac{2}{5} \times \frac{1}{4} =$

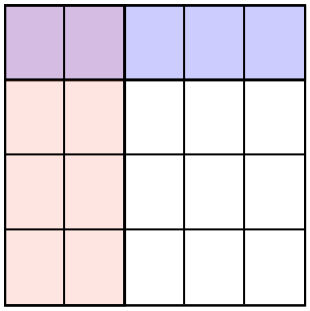

5) $\frac{5}{9} \times \frac{4}{6} =$

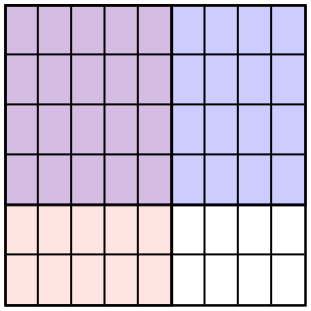

6) $\frac{1}{5} \times \frac{1}{3} =$

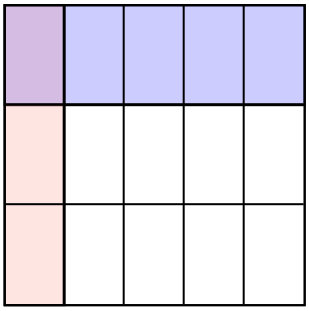

7) $\frac{3}{5} \times \frac{1}{3} =$

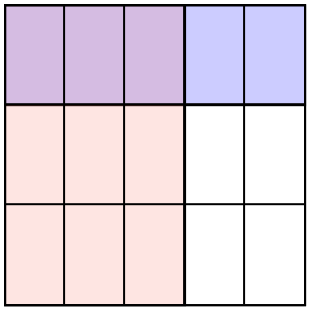

8) $\frac{1}{4} \times \frac{3}{5} =$



9) $\frac{1}{3} \times \frac{1}{2} =$



10) $\frac{2}{3} \times \frac{6}{8} =$

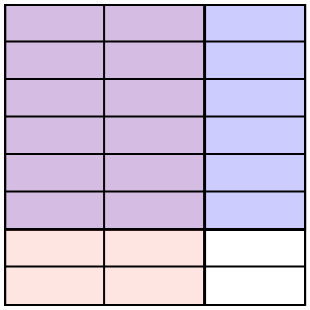

11) $\frac{1}{2} \times \frac{1}{2} =$



Risposte

Es. $\frac{10}{63}$

1. $\frac{9}{28}$
2. $\frac{7}{72}$
3. $\frac{2}{49}$
4. $\frac{2}{20}$
5. $\frac{20}{54}$
6. $\frac{1}{15}$
7. $\frac{3}{15}$
8. $\frac{3}{20}$
9. $\frac{1}{6}$
10. $\frac{12}{24}$
11. $\frac{1}{4}$