Moltiplicazioni con le frazioni (graficamente)

Nome:

Usa i quadrati per rappresentare la moltiplicazione indicata.

Es) $\frac{4}{5} \times \frac{2}{3} =$

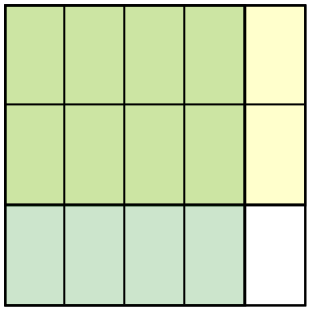

1) $\frac{2}{5} \times \frac{3}{6} =$

2) $\frac{5}{8} \times \frac{3}{6} =$

3) $\frac{3}{7} \times \frac{2}{3} =$

4) $\frac{2}{5} \times \frac{4}{7} =$

5) $\frac{2}{5} \times \frac{1}{9} =$

6) $\frac{1}{3} \times \frac{3}{4} =$

7) $\frac{5}{7} \times \frac{4}{6} =$

8) $\frac{6}{7} \times \frac{1}{2} =$

9) $\frac{1}{2} \times \frac{1}{7} =$

10) $\frac{3}{7} \times \frac{2}{8} =$

11) $\frac{3}{5} \times \frac{1}{3} =$

Risposte

Es. $\frac{8}{15}$

1. _____
2. _____
3. _____
4. _____
5. _____
6. _____
7. _____
8. _____
9. _____
10. _____
11. _____

1-10	91	82	73	64	55	45	36	27	18	9
11	0									

Moltiplicazioni con le frazioni (graficamente) Nome: **Soluzioni**

Usa i quadrati per rappresentare la moltiplicazione indicata.

Es) $\frac{4}{5} \times \frac{2}{3} =$

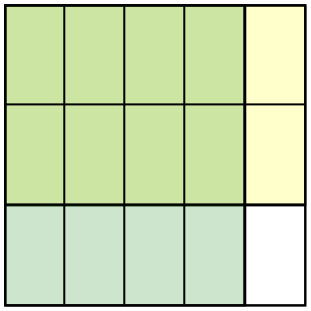

1) $\frac{2}{5} \times \frac{3}{6} =$

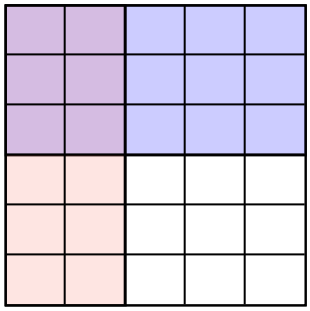

2) $\frac{5}{8} \times \frac{3}{6} =$

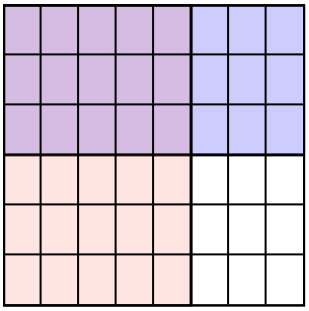

3) $\frac{3}{7} \times \frac{2}{3} =$

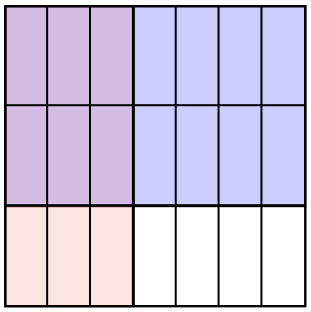

4) $\frac{2}{5} \times \frac{4}{7} =$

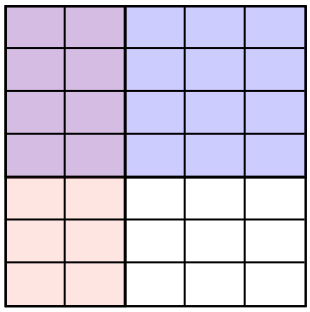

5) $\frac{2}{5} \times \frac{1}{9} =$

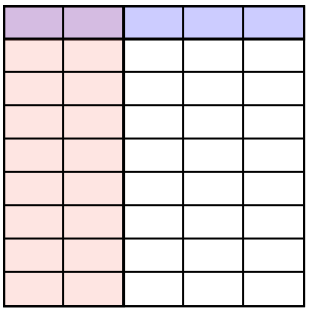

6) $\frac{1}{3} \times \frac{3}{4} =$



7) $\frac{5}{7} \times \frac{4}{6} =$

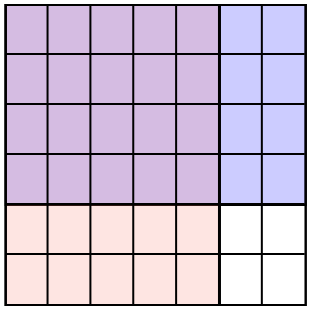

8) $\frac{6}{7} \times \frac{1}{2} =$

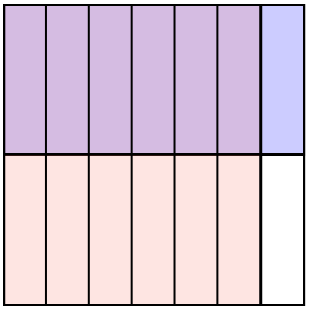

9) $\frac{1}{2} \times \frac{1}{7} =$

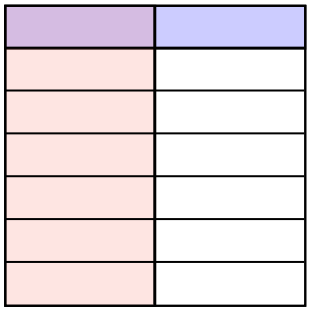

10) $\frac{3}{7} \times \frac{2}{8} =$

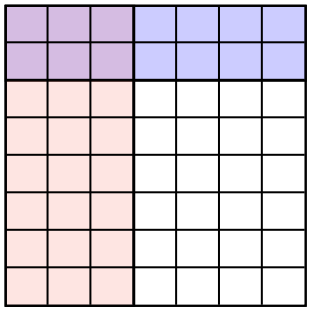

11) $\frac{3}{5} \times \frac{1}{3} =$

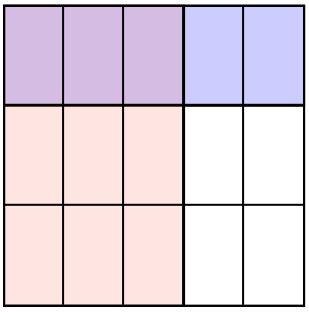

Risposte

Es. $\frac{8}{15}$

1. $\frac{6}{30}$
2. $\frac{15}{48}$
3. $\frac{6}{21}$
4. $\frac{8}{35}$
5. $\frac{2}{45}$
6. $\frac{3}{12}$
7. $\frac{20}{42}$
8. $\frac{6}{14}$
9. $\frac{1}{14}$
10. $\frac{6}{56}$
11. $\frac{3}{15}$

1-10	91	82	73	64	55	45	36	27	18	9
11	0									