Moltiplicazioni con le frazioni (graficamente)

Nome:

Usa i quadrati per rappresentare la moltiplicazione indicata.

Es) $\frac{3}{7} \times \frac{6}{9} =$

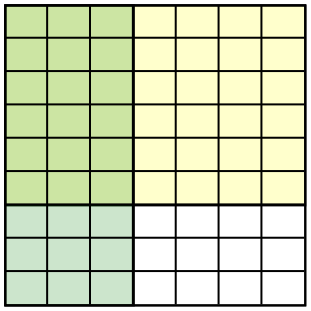

1) $\frac{1}{4} \times \frac{1}{4} =$

2) $\frac{4}{7} \times \frac{1}{3} =$

3) $\frac{8}{9} \times \frac{2}{6} =$

4) $\frac{1}{7} \times \frac{4}{8} =$

5) $\frac{1}{2} \times \frac{5}{8} =$

6) $\frac{1}{6} \times \frac{1}{7} =$

7) $\frac{3}{4} \times \frac{4}{6} =$

8) $\frac{1}{9} \times \frac{2}{6} =$

9) $\frac{1}{5} \times \frac{4}{7} =$

10) $\frac{4}{6} \times \frac{1}{2} =$

11) $\frac{1}{3} \times \frac{5}{8} =$

Risposte

Es. 18/63

1. _____
2. _____
3. _____
4. _____
5. _____
6. _____
7. _____
8. _____
9. _____
10. _____
11. _____

1-10	91	82	73	64	55	45	36	27	18	9
11	0									

Moltiplicazioni con le frazioni (graficamente) Nome: **Soluzioni**

Usa i quadrati per rappresentare la moltiplicazione indicata.

Es) $\frac{3}{7} \times \frac{6}{9} =$

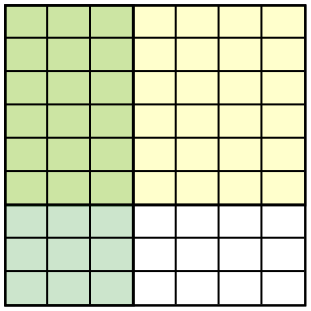

1) $\frac{1}{4} \times \frac{1}{4} =$



2) $\frac{4}{7} \times \frac{1}{3} =$

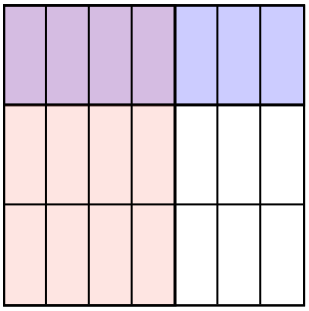

3) $\frac{8}{9} \times \frac{2}{6} =$

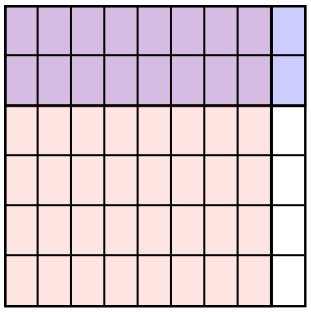

4) $\frac{1}{7} \times \frac{4}{8} =$

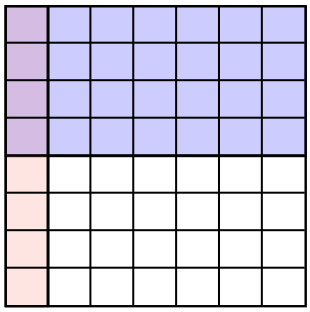

5) $\frac{1}{2} \times \frac{5}{8} =$

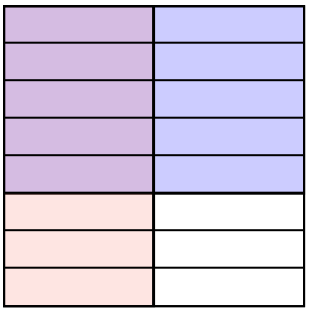

6) $\frac{1}{6} \times \frac{1}{7} =$

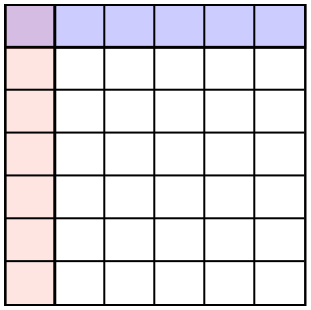

7) $\frac{3}{4} \times \frac{4}{6} =$

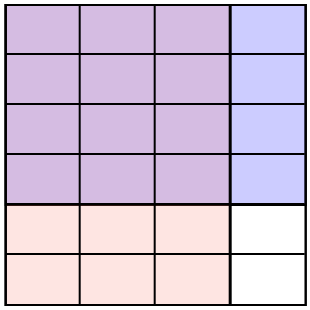

8) $\frac{1}{9} \times \frac{2}{6} =$

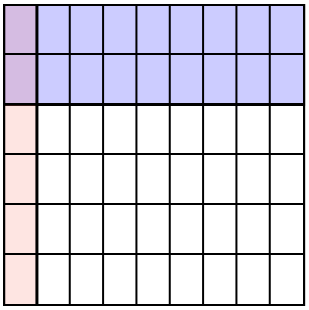

9) $\frac{1}{5} \times \frac{4}{7} =$

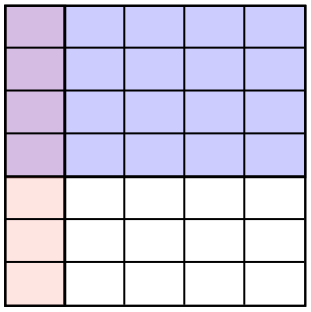

10) $\frac{4}{6} \times \frac{1}{2} =$

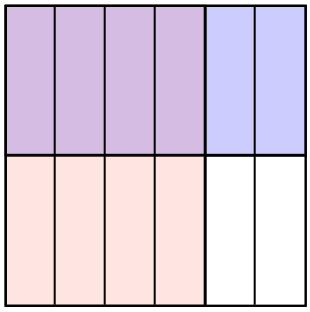

11) $\frac{1}{3} \times \frac{5}{8} =$

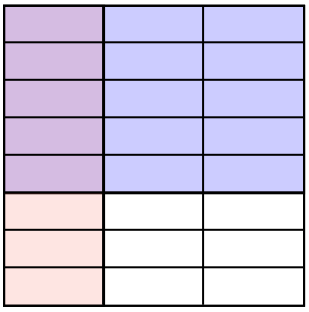

Risposte

Es. $\frac{18}{63}$

1. $\frac{1}{16}$
2. $\frac{4}{21}$
3. $\frac{16}{54}$
4. $\frac{4}{56}$
5. $\frac{5}{16}$
6. $\frac{1}{42}$
7. $\frac{12}{24}$
8. $\frac{2}{54}$
9. $\frac{4}{35}$
10. $\frac{4}{12}$
11. $\frac{5}{24}$

1-10	91	82	73	64	55	45	36	27	18	9
11	0									