Frazioni improprie e miste rappresentate Nome:

Scrivi ogni quantità come un numero misto.

1) 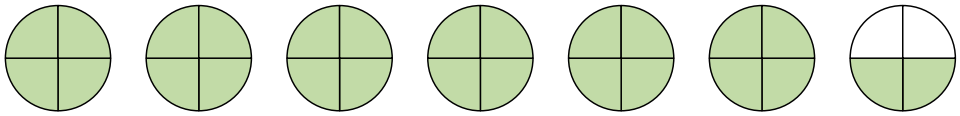

2) 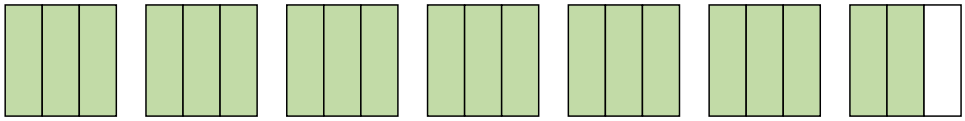

3) 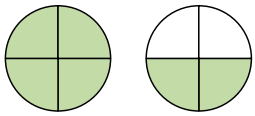

4) 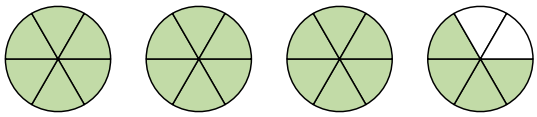

5) 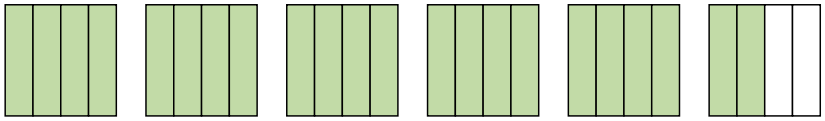

Scrivi ogni quantità come una frazione impropria.

6) 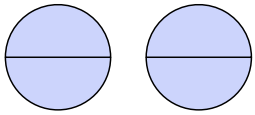

7) 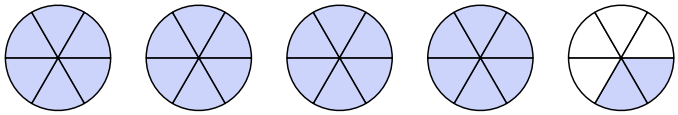

8) 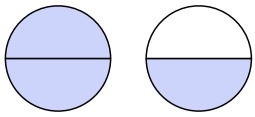

9) 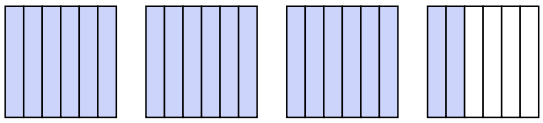

10) 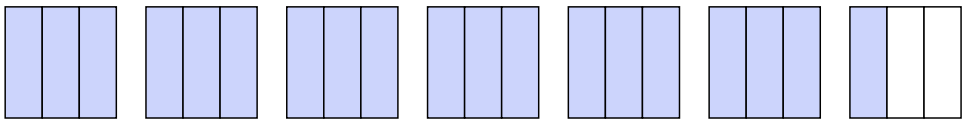

11) 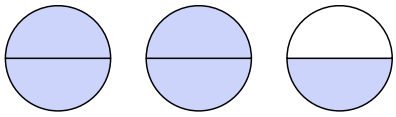

Risposte

1. _____
2. _____
3. _____
4. _____
5. _____
6. _____
7. _____
8. _____
9. _____
10. _____
11. _____

1-10	91	82	73	64	55	45	36	27	18	9
11	0									

Frazioni improprie e miste rappresentate

Nome: **Soluzioni**

Scrivi ogni quantità come un numero misto.

1) 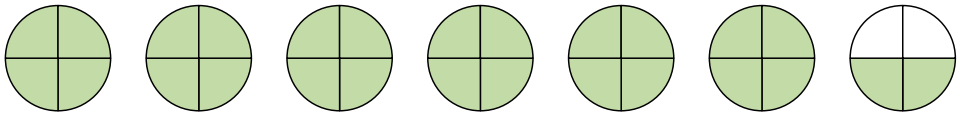

2) 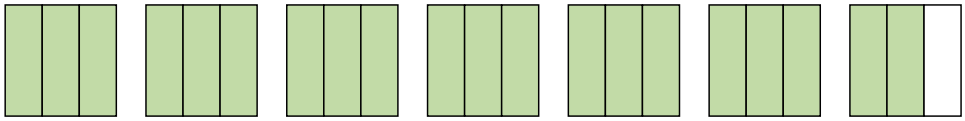

3) 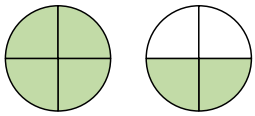

4) 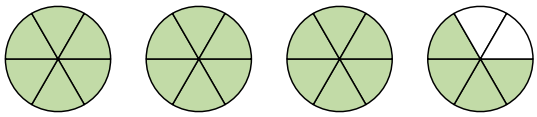

5) 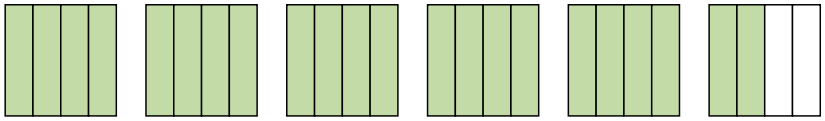

Scrivi ogni quantità come una frazione impropria.

6) 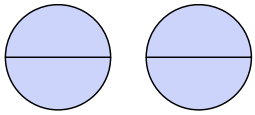

7) 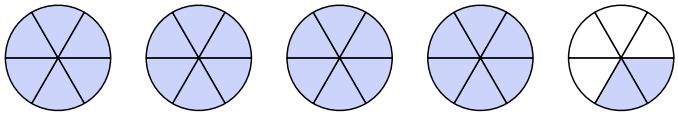

8) 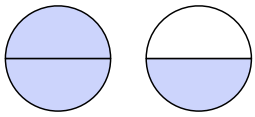

9) 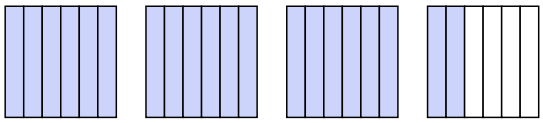

10) 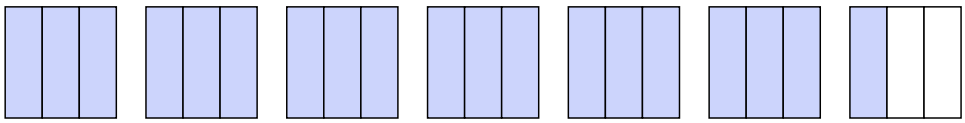

11) 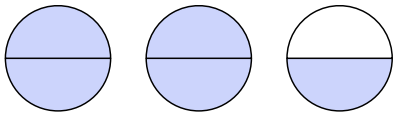

Risposte

1. $6\,^{2}/_{4}$
2. $6\,^{2}/_{3}$
3. $1\,^{2}/_{4}$
4. $3\,^{4}/_{6}$
5. $5\,^{2}/_{4}$
6. $^{4}/_{2}$
7. $^{26}/_{6}$
8. $^{3}/_{2}$
9. $^{20}/_{6}$
10. $^{19}/_{3}$
11. $^{5}/_{2}$