Frazioni improprie e miste rappresentate graficamente Nome:

Scrivi ogni quantità come un numero misto.

1) 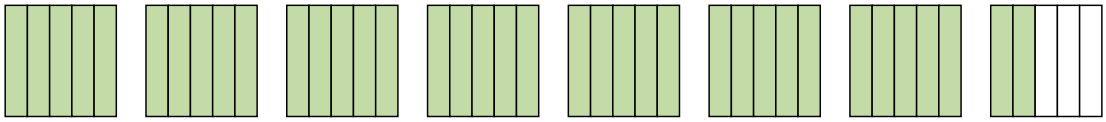

2) 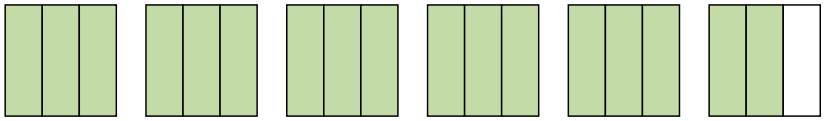

3) 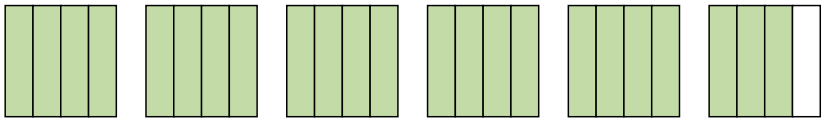

4) 

5) 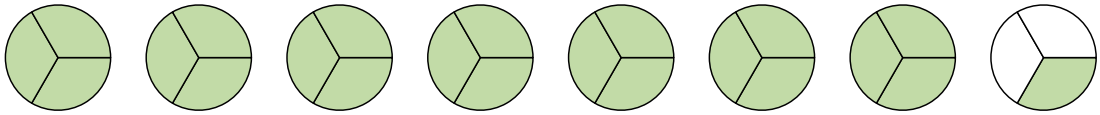

Scrivi ogni quantità come una frazione impropria.

6) 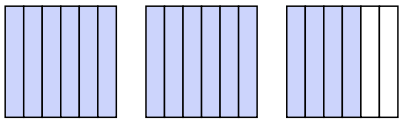

7) 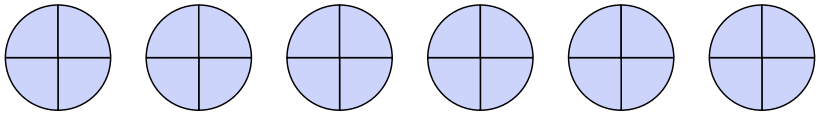

8) 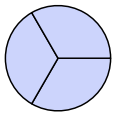

9) 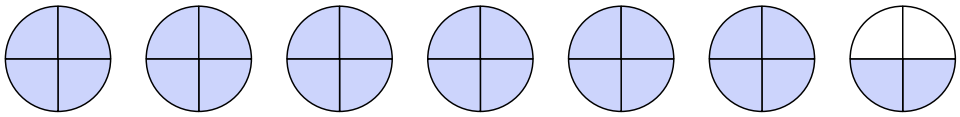

10) 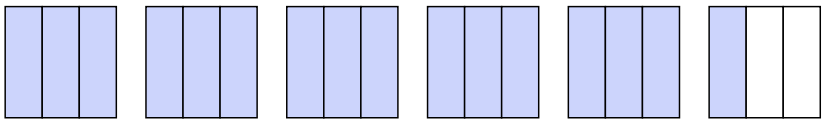

11) 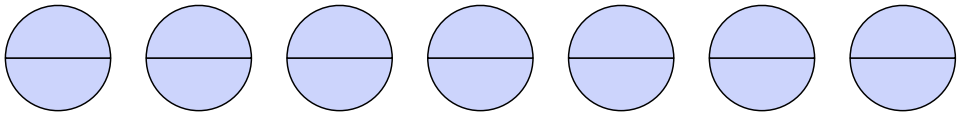

Risposte

1. _____
2. _____
3. _____
4. _____
5. _____
6. _____
7. _____
8. _____
9. _____
10. _____
11. _____

1-10	91	82	73	64	55	45	36	27	18	9
11	0									

Frazioni improprie e miste rappresentate graficamente Nome: **Soluzioni**

Scrivi ogni quantità come un numero misto.

1) 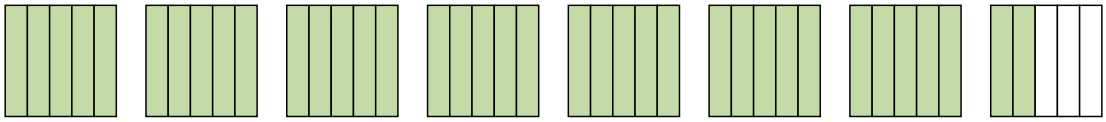

2) 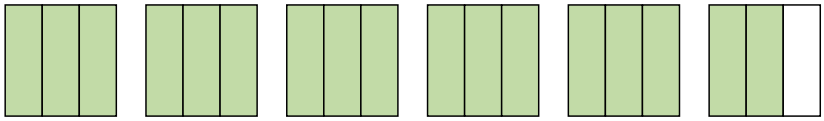

3) 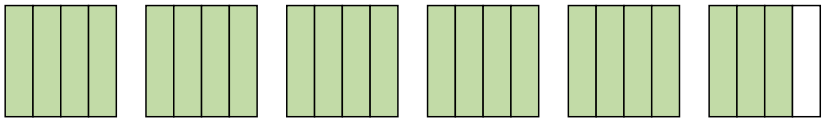

4) 

5) 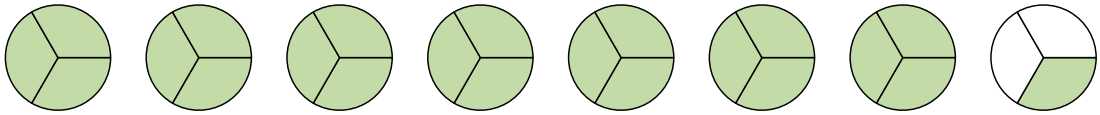

Scrivi ogni quantità come una frazione impropria.

6) 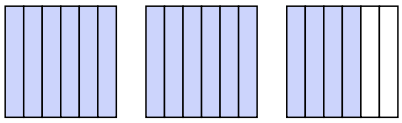

7) 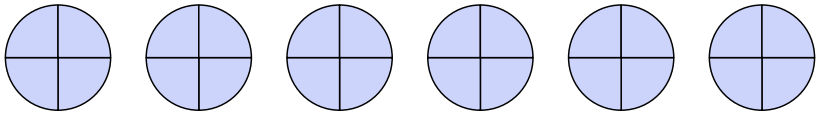

8) 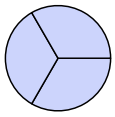

9) 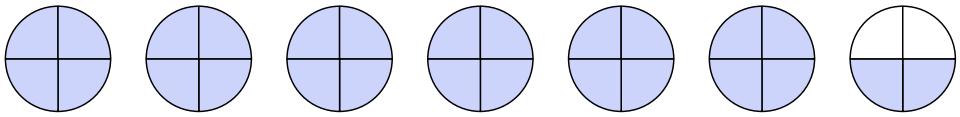

10) 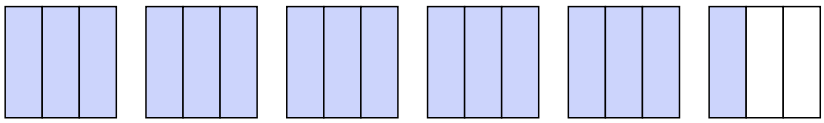

11) 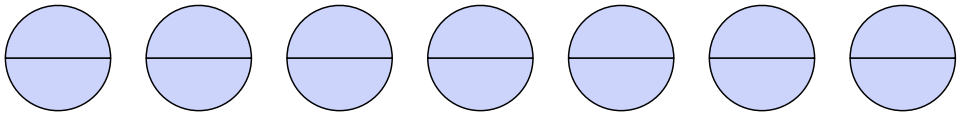

Risposte

1. $7\,^{2}/_{5}$
2. $5\,^{2}/_{3}$
3. $5\,^{3}/_{4}$
4. $4\,^{5}/_{6}$
5. $7\,^{1}/_{3}$
6. $^{16}/_{6}$
7. $^{24}/_{4}$
8. $^{3}/_{3}$
9. $^{26}/_{4}$
10. $^{16}/_{3}$
11. $^{14}/_{2}$

1-10	91	82	73	64	55	45	36	27	18	9
11	0									