Frazioni improprie e miste rappresentate graficamente Nome:

Scrivi ogni quantità come un numero misto.

1) 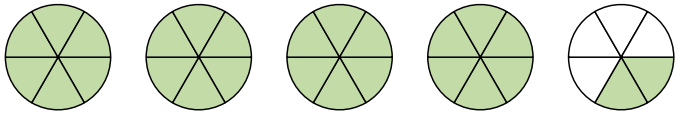

2) 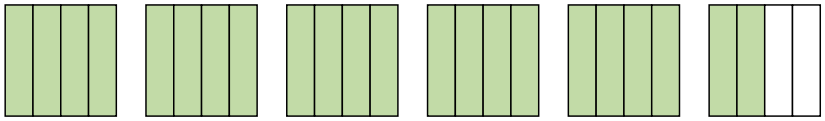

3) 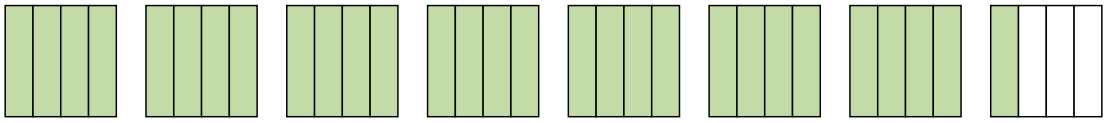

4) 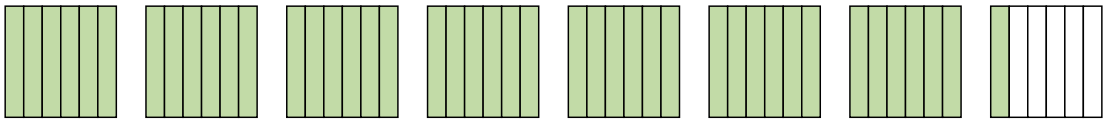

5) 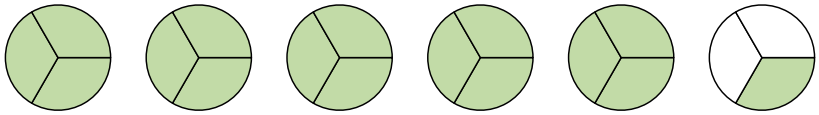

Scrivi ogni quantità come una frazione impropria.

6) 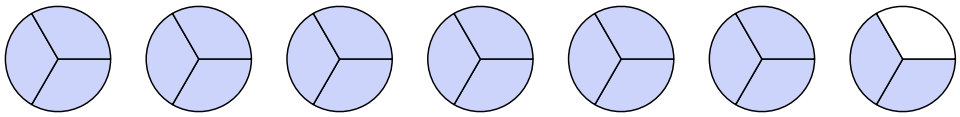

7) 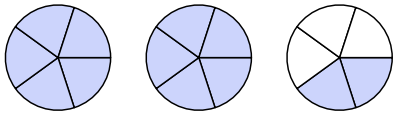

8) 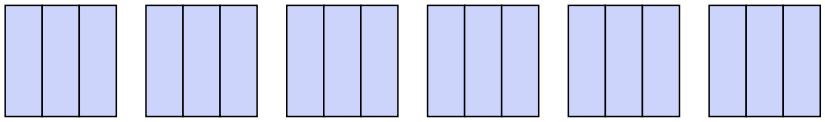

9) 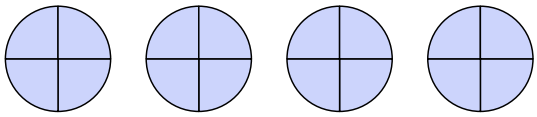

10) 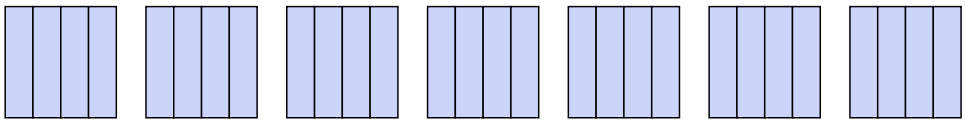

11) 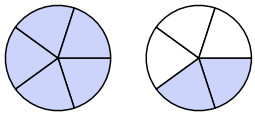

Risposte

1. _____
2. _____
3. _____
4. _____
5. _____
6. _____
7. _____
8. _____
9. _____
10. _____
11. _____

1-10	91	82	73	64	55	45	36	27	18	9
11	0									

Frazioni improprie e miste rappresentate graficamente Nome: **Soluzioni**

Scrivi ogni quantità come un numero misto.

1) 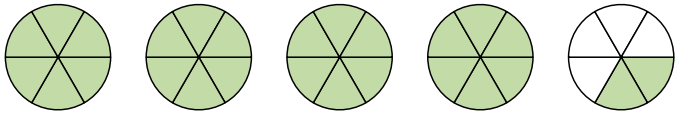

2) 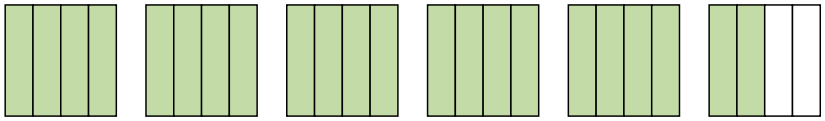

3) 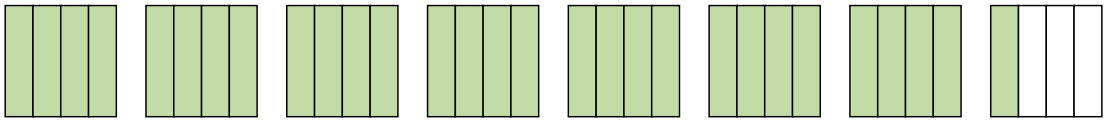

4) 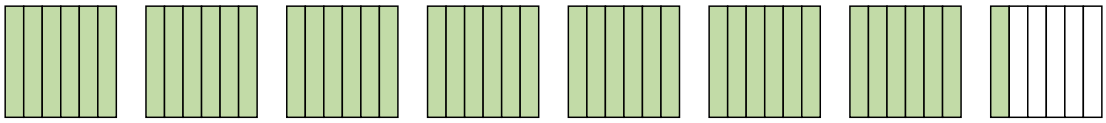

5) 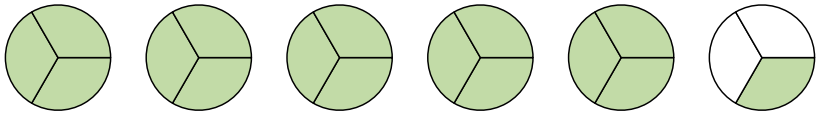

Scrivi ogni quantità come una frazione impropria.

6) 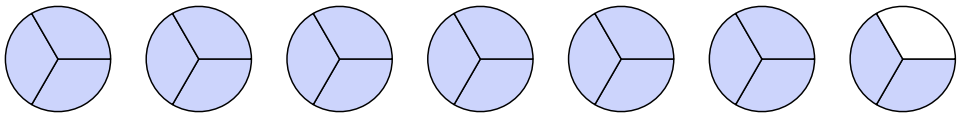

7) 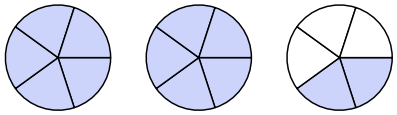

8) 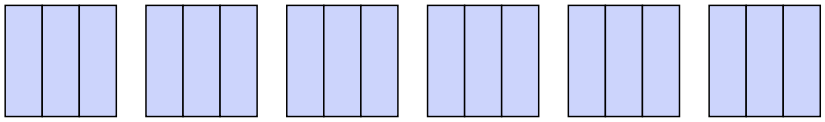

9) 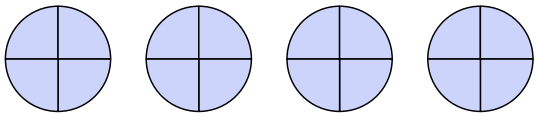

10) 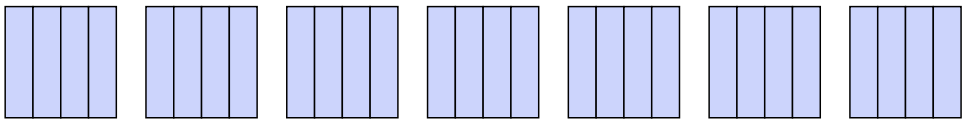

11) 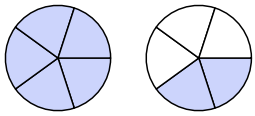

Risposte

1. $4\frac{2}{6}$
2. $5\frac{2}{4}$
3. $7\frac{1}{4}$
4. $7\frac{1}{6}$
5. $5\frac{1}{3}$
6. $\frac{20}{3}$
7. $\frac{12}{5}$
8. $\frac{18}{3}$
9. $\frac{16}{4}$
10. $\frac{28}{4}$
11. $\frac{7}{5}$

1-10	91	82	73	64	55	45	36	27	18	9
11	0									