Frazioni di quantità relative al tutto

Nome:

Risolvi ogni problema.

Es) Indica i triangoli come una frazione dell'intero.

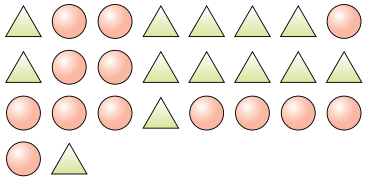

1) Indica le stelle come una frazione dell'intero.

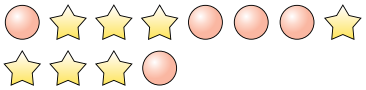

2) Indica i triangoli come una frazione dell'intero.

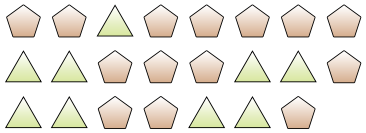

3) Indica le lune come una frazione dell'intero.



4) Indica le stelle come una frazione dell'intero.



5) Indica i cuori come una frazione dell'intero.

6) Indica i cuori come una frazione dell'intero.



7) Indica le stelle come una frazione dell'intero.

8) Indica i cerchi come una frazione dell'intero.

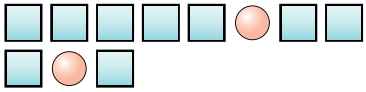

9) Indica i cerchi come una frazione dell'intero.



10) Indica i pentagoni come una frazione dell'intero.

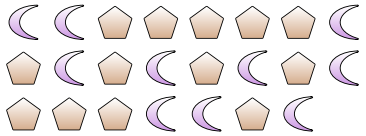

11) Indica i cuori come una frazione dell'intero.

Risposte

Es. 13/26

1. _____
2. _____
3. _____
4. _____
5. _____
6. _____
7. _____
8. _____
9. _____
10. _____
11. _____

Frazioni di quantità relative al tutto

Nome: **Soluzioni**

Risolvi ogni problema.

Es) Indica i triangoli come una frazione dell'intero.

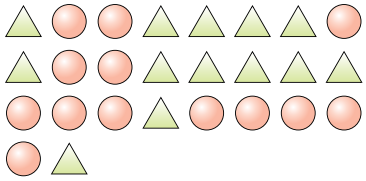

1) Indica le stelle come una frazione dell'intero.

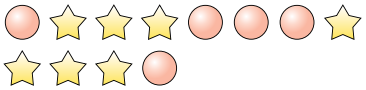

2) Indica i triangoli come una frazione dell'intero.

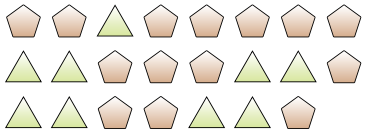

3) Indica le lune come una frazione dell'intero.



4) Indica le stelle come una frazione dell'intero.



5) Indica i cuori come una frazione dell'intero.

6) Indica i cuori come una frazione dell'intero.



7) Indica le stelle come una frazione dell'intero.

8) Indica i cerchi come una frazione dell'intero.

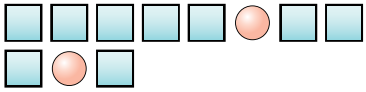

9) Indica i cerchi come una frazione dell'intero.



10) Indica i pentagoni come una frazione dell'intero.

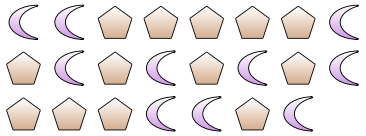

11) Indica i cuori come una frazione dell'intero.

Risposte

Es.	13/26
1.	7/12
2.	9/23
3.	8/20
4.	8/10
5.	7/12
6.	14/25
7.	10/14
8.	2/11
9.	8/17
10.	13/23
11.	4/15