Divisioni con la linea numerata Nome:

**Usa la linea numerata per risolvere ogni problema.**

**1)** 50 : 10 =

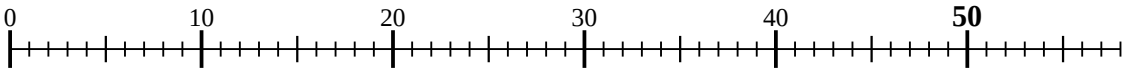


**2)** 30 : 6 =

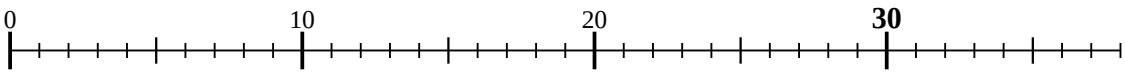


**3)** 24 : 6 =

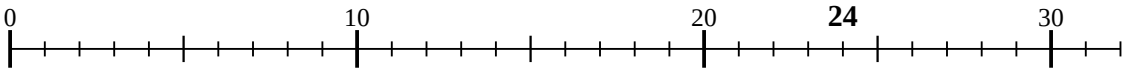


**4)** 15 : 5 =

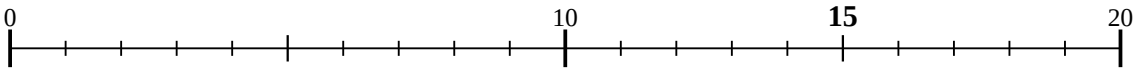


**5)** 16 : 4 =

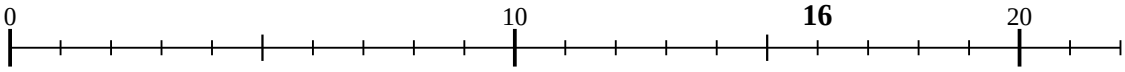


**6)** 28 : 7 =

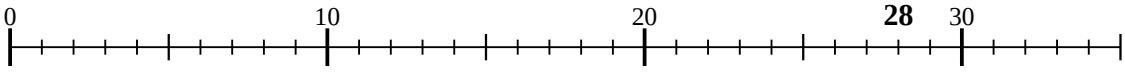


**7)** 20 : 10 =

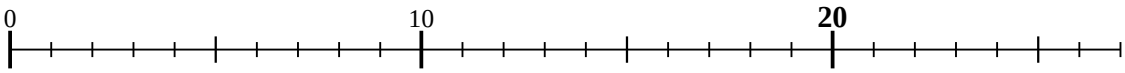


**8)** 10 : 2 =

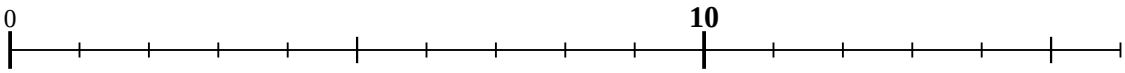


**9)** 24 : 8 =

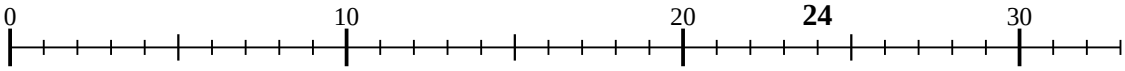


**10)** 9 : 3 =

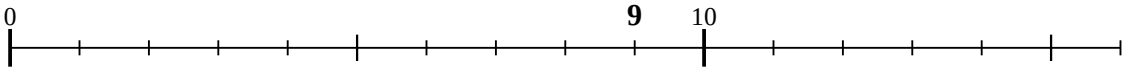


**11)** 6 : 2 =

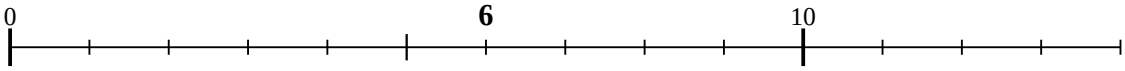


**Risposte**

1. _____
2. _____
3. _____
4. _____
5. _____
6. _____
7. _____
8. _____
9. _____
10. _____
11. _____

Divisioni con la linea numerata

Nome: **Soluzioni**

**Usa la linea numerata per risolvere ogni problema.**

**1)** 50 : 10 =

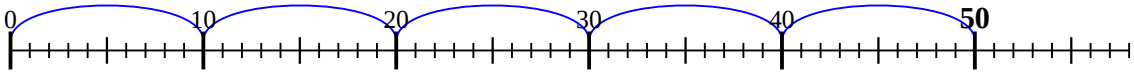


**2)** 30 : 6 =

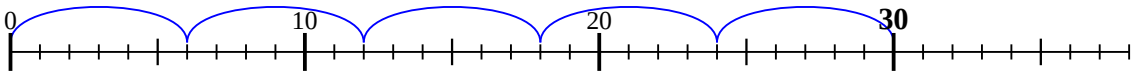


**3)** 24 : 6 =

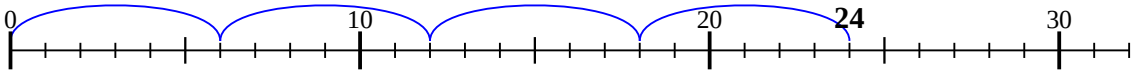


**4)** 15 : 5 =

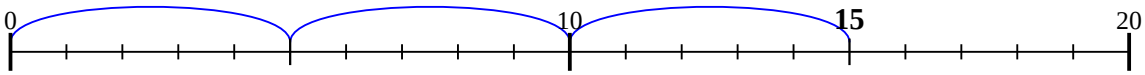


**5)** 16 : 4 =

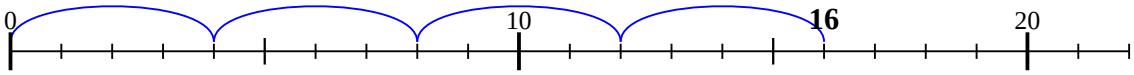


**6)** 28 : 7 =

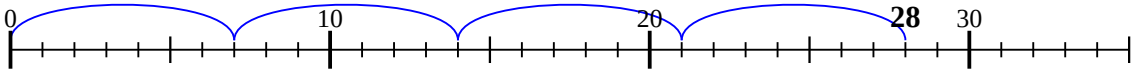


**7)** 20 : 10 =

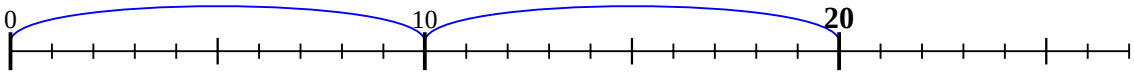


**8)** 10 : 2 =

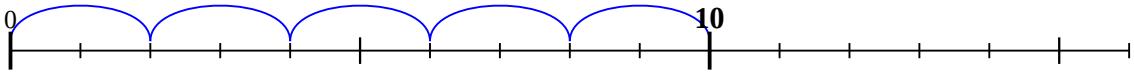


**9)** 24 : 8 =

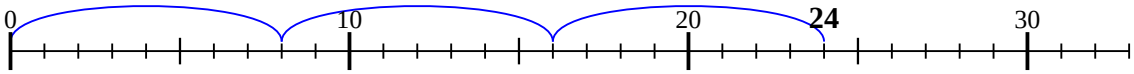


**10)** 9 : 3 =

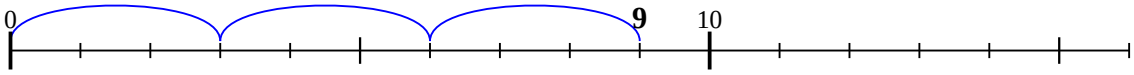


**11)** 6 : 2 =

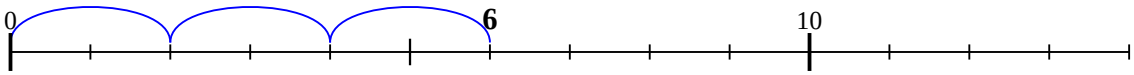


**Risposte**

1. 5
2. 5
3. 4
4. 3
5. 4
6. 4
7. 2
8. 5
9. 3
10. 3
11. 3