Contare le figure

Nome:

**Conta il numero delle forme in ogni quadrato.**



= 4 = _____ = _____ = _____

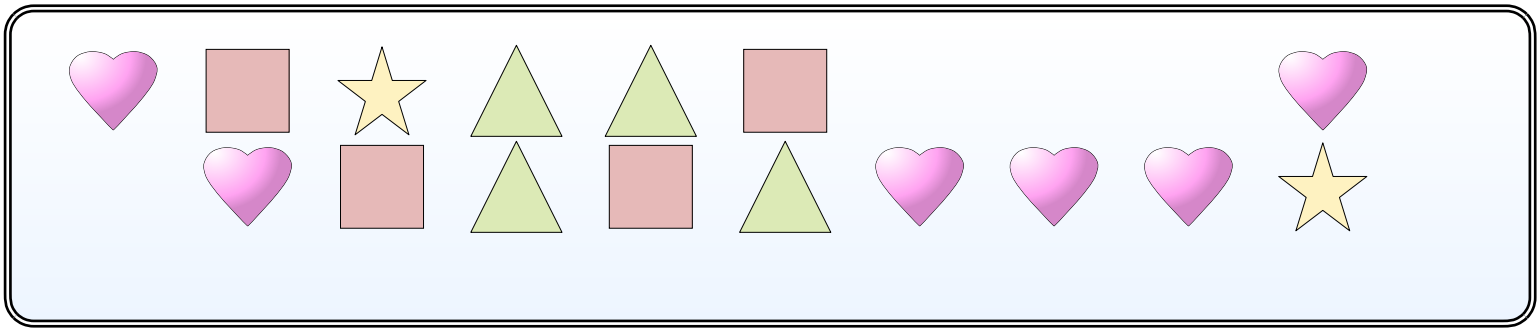

= _____ = _____ = _____ = _____



= _____ = _____  = _____ = _____

Contare le figure

Nome: **Soluzioni**

**Conta il numero delle forme in ogni quadrato.**



= 4

= 3

= 5

= 6

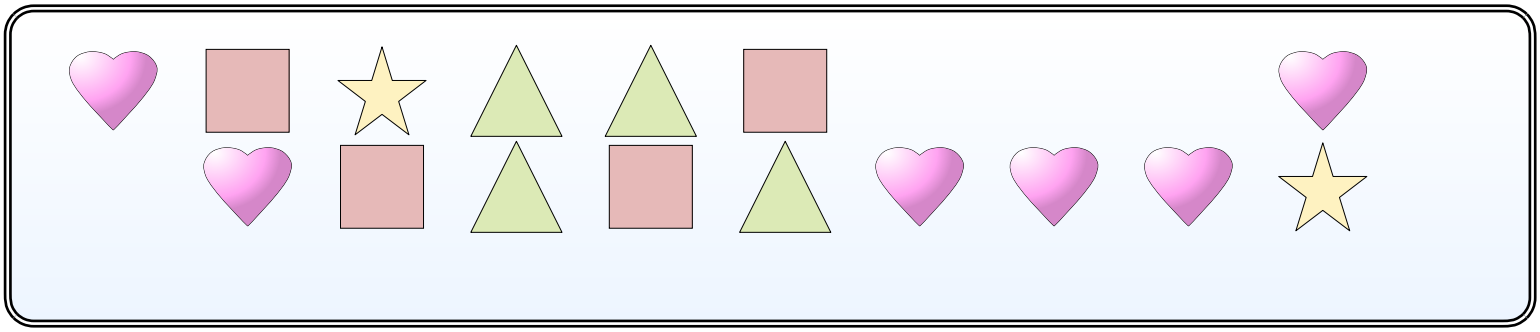

= 6

= 4

= 2

= 4



= 4

= 2

 = 5

= 8



| | | | | | | | | | | |
|---|---|---|---|---|---|---|---|---|---|---|
| 1-10 | 91 | 82 | 73 | 64 | 55 | 45 | 36 | 27 | 18 | 9 |
| 11 | 0 | | | | | | | | | |