Contare le figure

Nome:

Conta il numero delle forme in ogni quadrato.

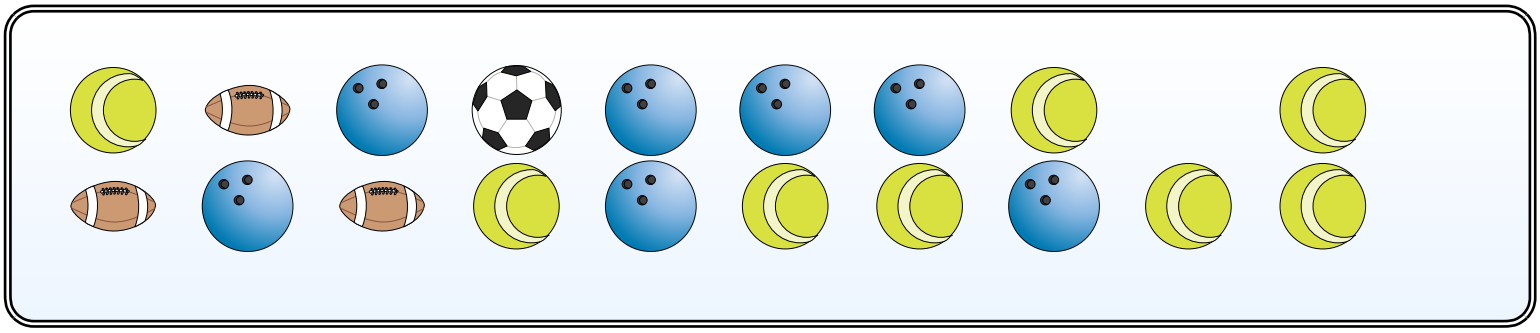

= 8

= _____

 = _____

= _____



= _____

= _____

= _____

= _____



= _____

 = _____

= _____

= _____

1-10	91	82	73	64	55	45	36	27	18	9
11	0									

Nome: **Soluzioni**

Conta il numero delle forme in ogni quadrato.

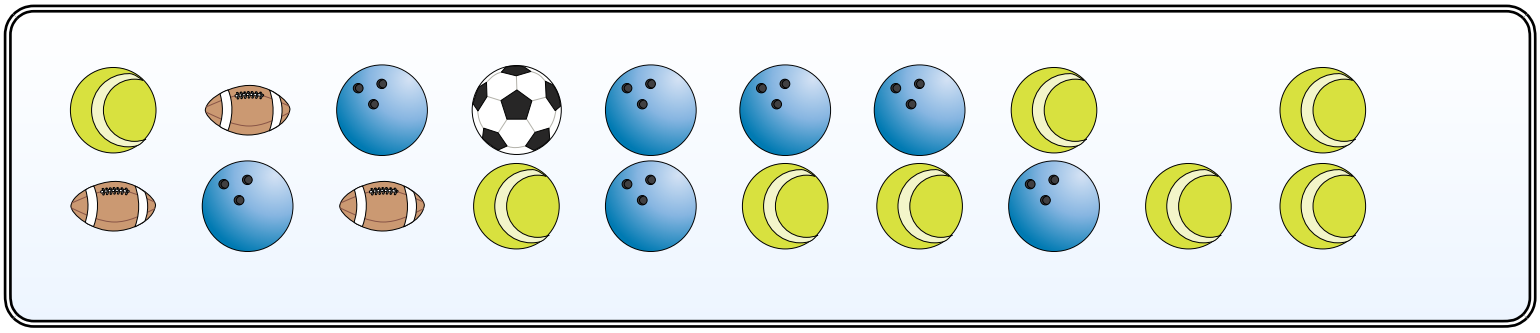

= 8

= 3

 = 7

= 1



= 3

= 5

= 5

= 6



= 5

 = 2

= 3

= 8

1-10	91	82	73	64	55	45	36	27	18	9
11	0									