Contare le figure

Nome:

Conta il numero delle forme in ogni quadrato.



= 4 = _____ = _____ = _____

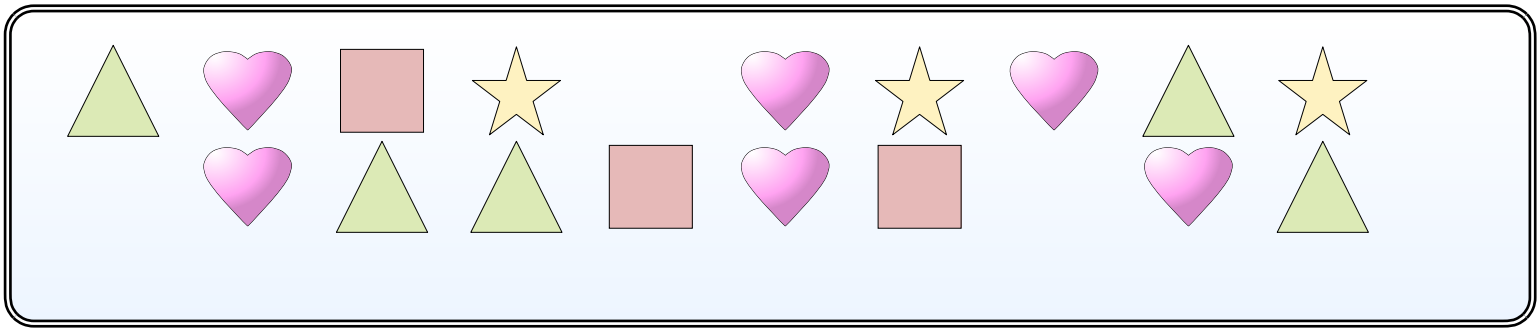

= _____ = _____ = _____ = _____



= _____ = _____  = _____ = _____

1-10	91	82	73	64	55	45	36	27	18	9
11	0									

Nome: **Soluzioni**

Conta il numero delle forme in ogni quadrato.



= 4

= 4

= 5

= 4

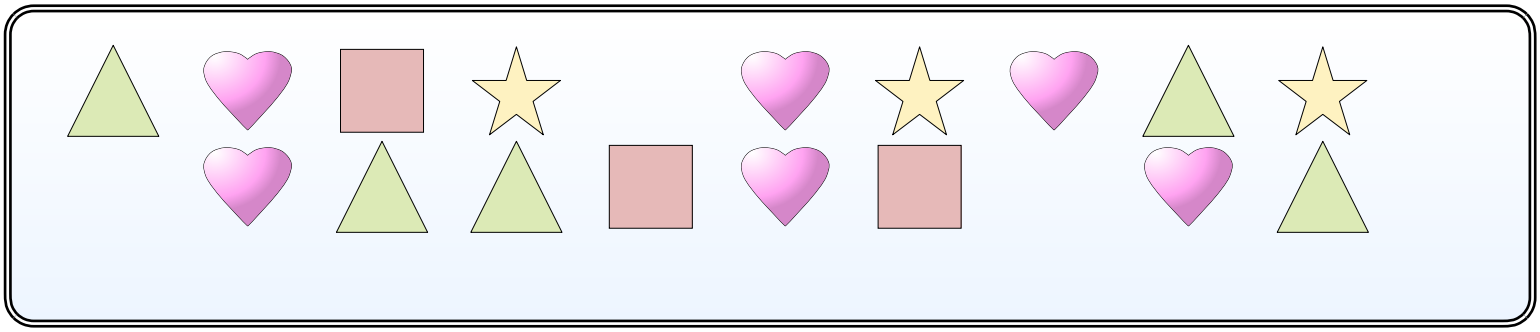

= 5

= 6

= 3

= 3



= 5

= 4

 = 4

= 5

1-10	91	82	73	64	55	45	36	27	18	9
11	0									