Trovare gli angoli nelle figure

Nome:

Conta il nuemro di angoli "acuti", "ottusi", "retti" e "concavi" in ogni forma.

Es)

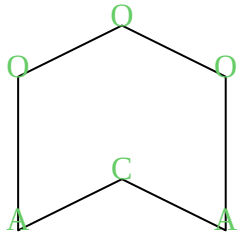

1)

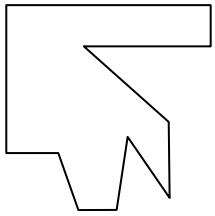

2)

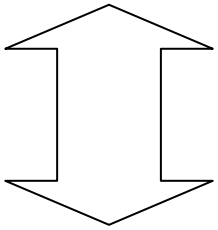

3)

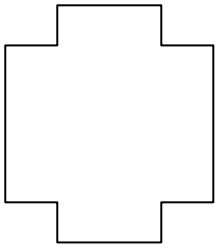

4)



5)

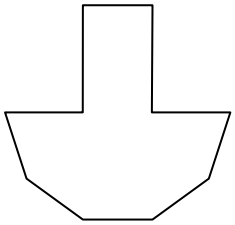

6)

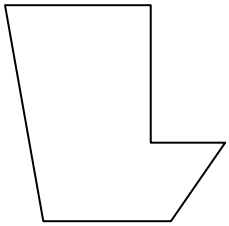

7)

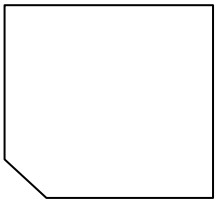

8)

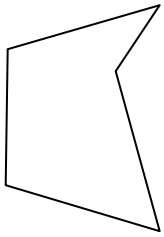

9)



10)

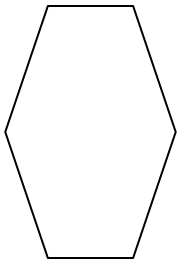

11)



Risposte

	A	O	R	C
Es.	2	3	0	1
1.				
2.				
3.				
4.				
5.				
6.				
7.				
8.				
9.				
10.				
11.				

1-10	91	82	73	64	55	45	36	27	18	9
11	0									

Trovare gli angoli nelle figure

Nome: **Soluzioni**

Conta il nuemro di angoli "acuti", "ottusi", "retti" e "concavi" in ogni forma.

Es)

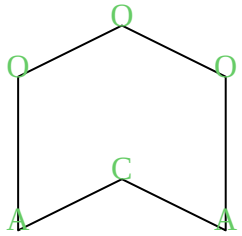

1)

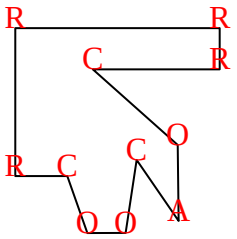

2)

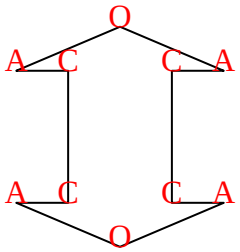

3)

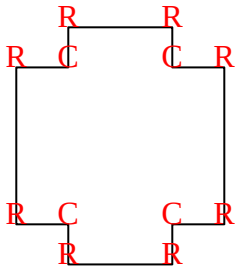

4)



5)

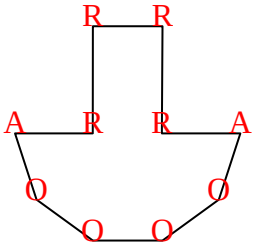

6)

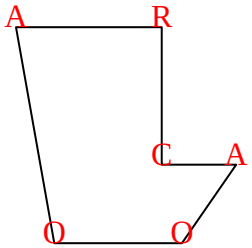

7)

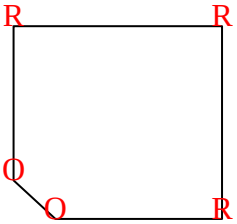

8)

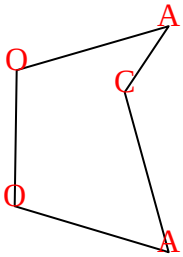

9)

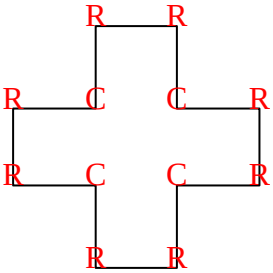

10)

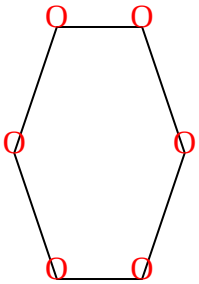

11)

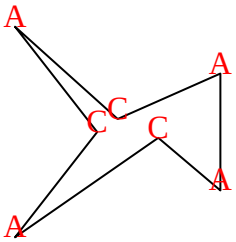

Risposte

	A	O	R	C
Es.	2	3	0	1
1.	1	3	4	3
2.	4	2	0	4
3.	0	0	8	4
4.	0	0	4	0
5.	2	4	4	0
6.	2	2	1	1
7.	0	2	3	0
8.	2	2	0	1
9.	0	0	8	4
10.	0	6	0	0
11.	4	0	0	3

1-10	91	82	73	64	55	45	36	27	18	9
11	0									