Trovare gli angoli nelle figure

Nome:

Conta il nuemro di angoli "acuti", "ottusi", "retti" e "concavi" in ogni forma.

Es)

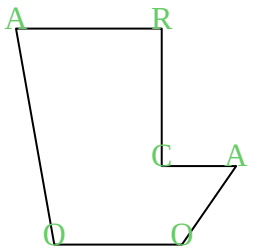

1)

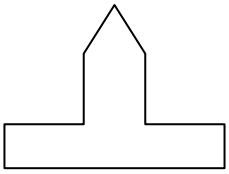

2)

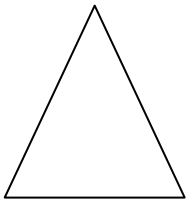

3)

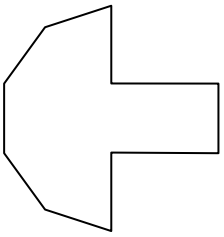

4)

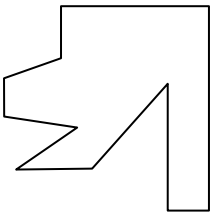

5)

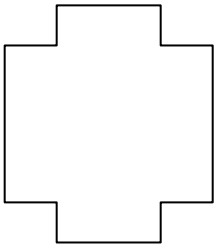

6)

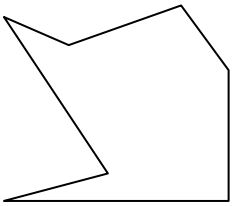

7)

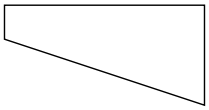

8)

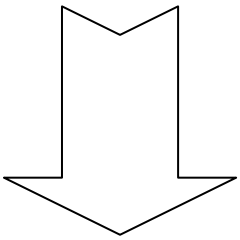

9)

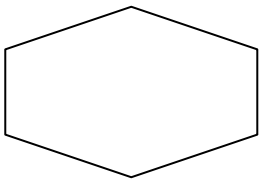

10)

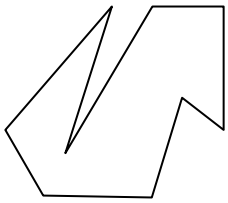

11)

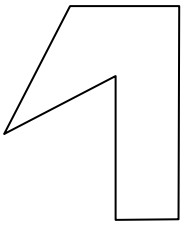

Risposte

	A	O	R	C
Es.	2	2	1	1
1.				
2.				
3.				
4.				
5.				
6.				
7.				
8.				
9.				
10.				
11.				

1-10	91	82	73	64	55	45	36	27	18	9
11	0									

Trovare gli angoli nelle figure

Nome: **Soluzioni**

Conta il nuemro di angoli "acuti", "ottusi", "retti" e "concavi" in ogni forma.

Es)

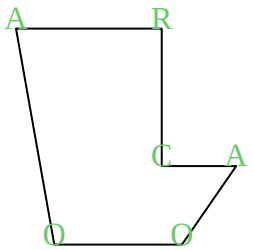

1)

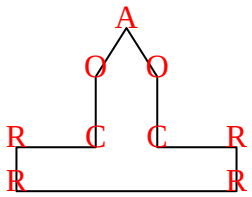

2)

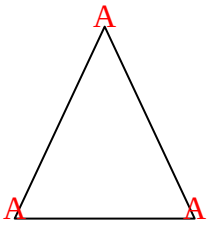

3)

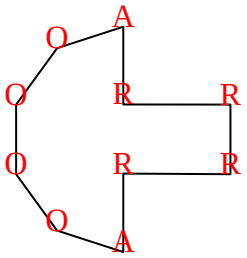

4)

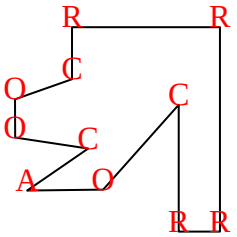

5)

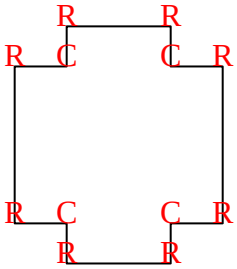

6)

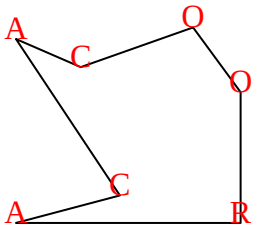

7)

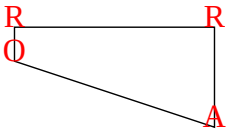

8)

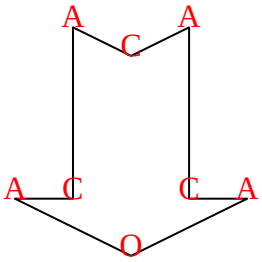

9)

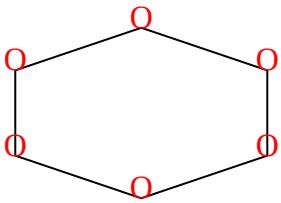

10)

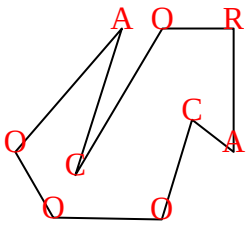

11)

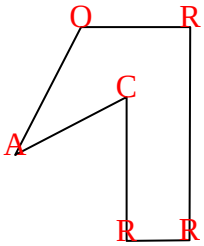

Risposte

	A	O	R	C
Es.	2	2	1	1
1.	1	2	4	2
2.	3	0	0	0
3.	2	4	4	0
4.	1	3	4	3
5.	0	0	8	4
6.	2	2	1	2
7.	1	1	2	0
8.	4	1	0	3
9.	0	6	0	0
10.	2	4	1	2
11.	1	1	3	1

1-10	91	82	73	64	55	45	36	27	18	9
11	0									