Trovare gli angoli nelle figure

Nome:

Conta il nuemro di angoli "acuti", "ottusi" e "retti" in ogni forma.

Es)

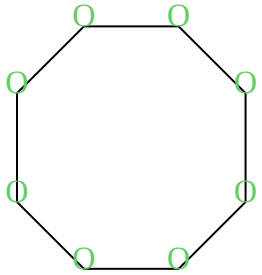

1)

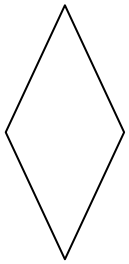

2)

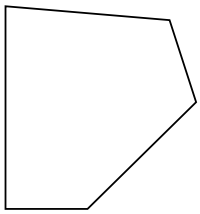

3)

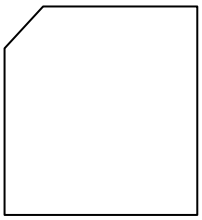

4)

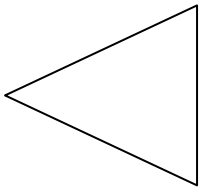

5)

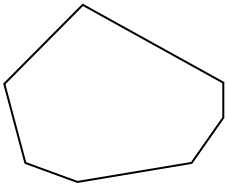

6)

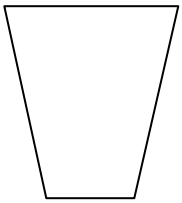

7)



8)

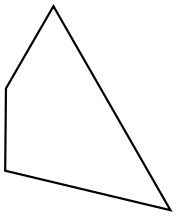

9)

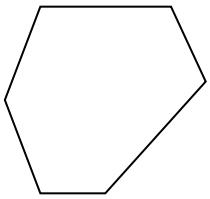

10)

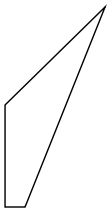

11)

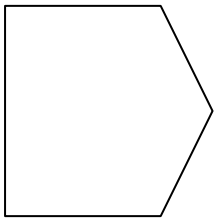

Risposte

	A	O	R
Es.	0	8	0
1.			
2.			
3.			
4.			
5.			
6.			
7.			
8.			
9.			
10.			
11.			

1-10	91	82	73	64	55	45	36	27	18	9
11	0									

Trovare gli angoli nelle figure

Nome: **Soluzioni**

Conta il nuemro di angoli "acuti", "ottusi" e "retti" in ogni forma.

Es)

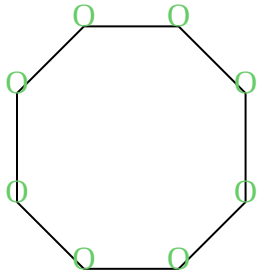

1)

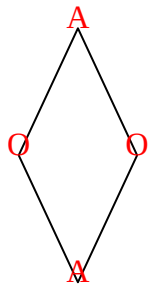

2)

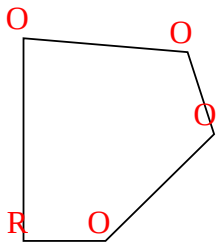

3)

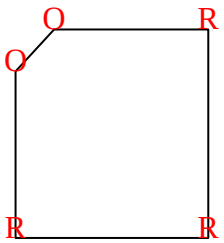

4)

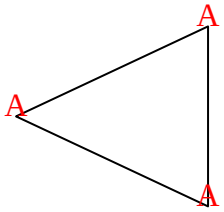

5)

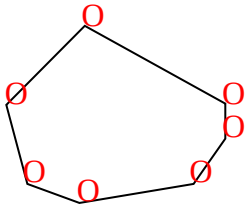

6)

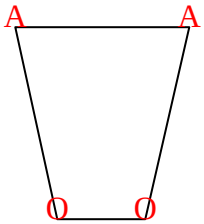

7)



8)

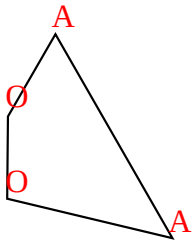

9)

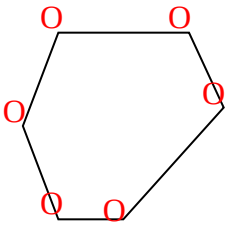

10)

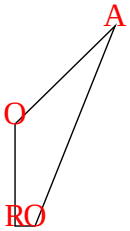

11)

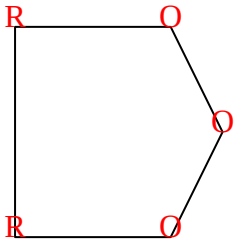

Risposte

	A	O	R
Es.	0	8	0
1.	2	2	0
2.	0	4	1
3.	0	2	3
4.	3	0	0
5.	0	7	0
6.	2	2	0
7.	0	0	4
8.	2	2	0
9.	0	6	0
10.	1	2	1
11.	0	3	2

1-10	91	82	73	64	55	45	36	27	18	9
11	0									